SARASAS PITTAYA SCHOOL

Grade 5 Mathematics

Name: _____ Student No. _____

A. Identify the name of the following solid figures.

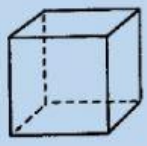

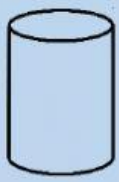



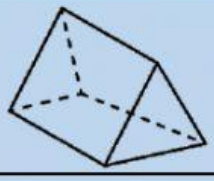

Rectangular prism | Cone | Cylinder

Triangular prism | Sphere | Cube

B. Identify the shape of the following objects.

Cone | Cylinder | Rectangular prism

Sphere | Cube | Triangular prism

LIVEWORKSHEETS