NÚMEROS

1. Indica el número anterior y el posterior:

	125			130	
	189			165	
	199			137	

2. Continúa las series

+ 2

102					

+ 3

133					

- 2

120					

+ 2

122					

LIVEWORKSHEETS

3. Une con flechas

100	Ciento veintitrés
123	Ciento treinta y dos
105	Cien
132	Ciento cinco
150	Ciento cincuenta

4. Completa las pirámides

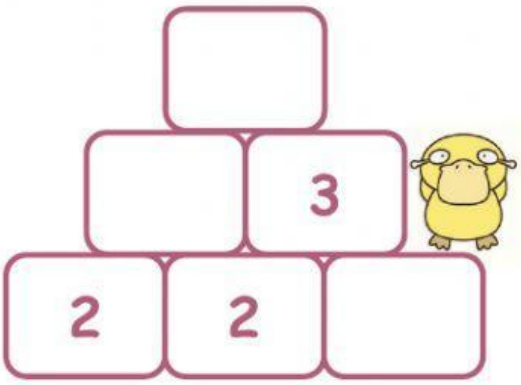

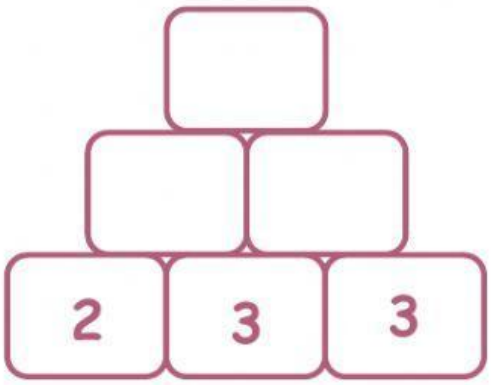

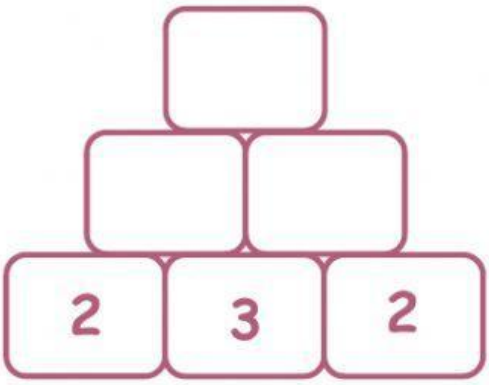

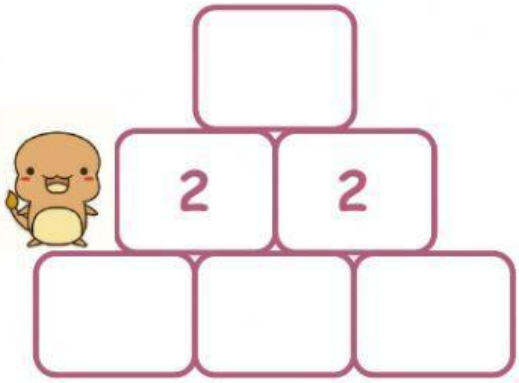

LIVEWORKSHEETS