ใบงาน เรื่อง ความสัมพันธ์เชิงเส้น

จงจับคู่สมการต่อไปนี้กับกราฟของสมการนั้น

1) $y = x + 6$	3) $y = 6 - x$	5) $y = 6$
2) $y = x - 6$	4) $y = -6x$	6) $y = -6$

ก.

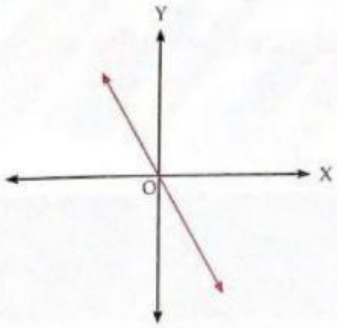

ข.

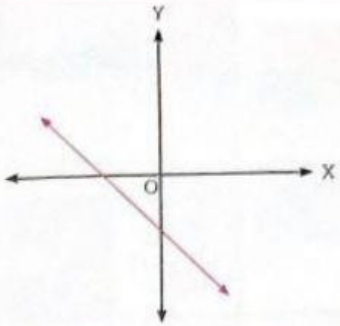

ค.

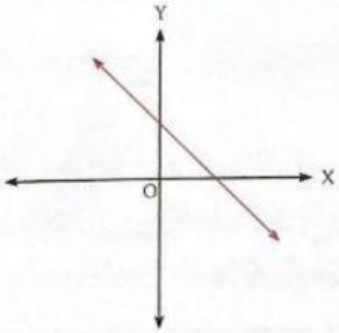

ง.

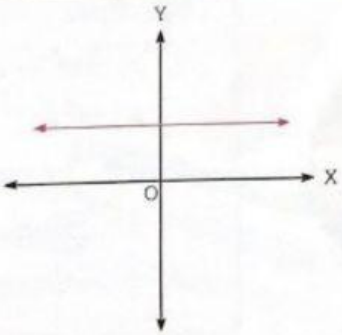

จ.

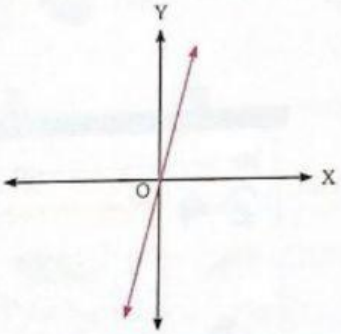

ฉ.

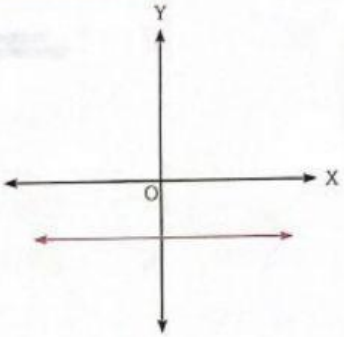

ช.

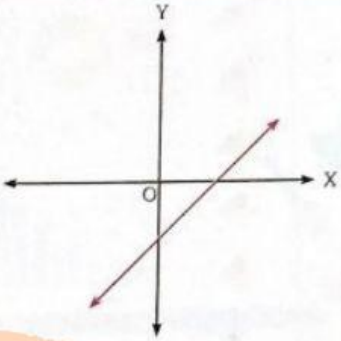

ซ.

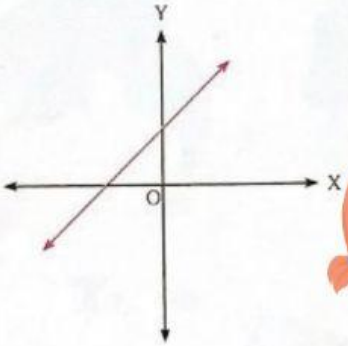

LIVEWORKSHEETS