Nombres del 11 al 15

❶ Marca amb una creu 10 objectes i escriu el nombre total.



❷ Uneix amb fletxes

14  quinze

15  dotze

12  catorze

3 Compta amb atenció quants hi ha en una dotzena i contesta les preguntes.

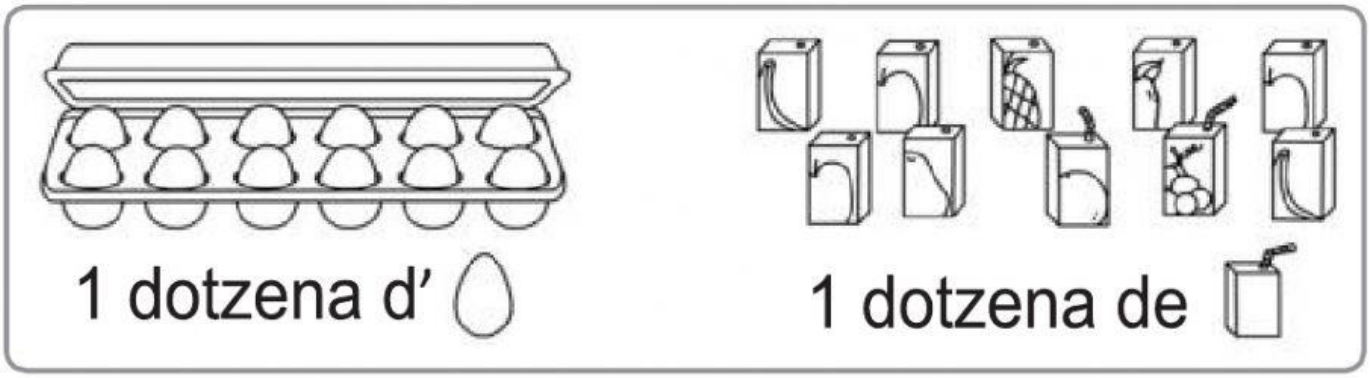

En una dotzena d'ous hi ha _____ ous.

En una dotzena de sucs hi ha _____ sucs.

4 Marca amb una creu els elements que fan una dotzena i ho escrius a sota.



Una _____



Una _____

5 Aparella la paraula amb el seu dibuix

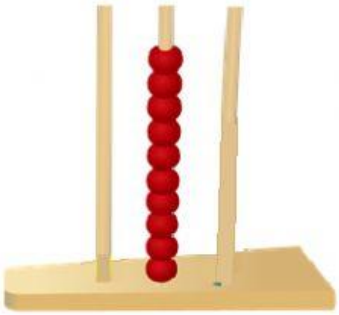



dotzena

desena

6 Arrossega les que s'indiquen



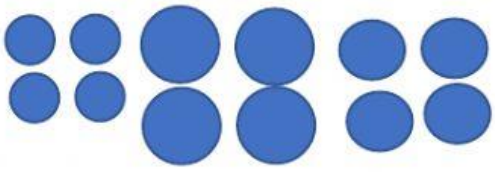

10△

12○

7 Escriu els nombres que falten

1		3				7			
11									

8 Escriu el resultat de les sumes

8 + 4 = ☐ 10 + 2 = ☐ 7 + 5 = ☐

9 + 3 = ☐ 11 + 1 = ☐ 6 + 6 = ☐