Grams and kilograms

Learn

1



2



How do these scales work?

Practise

1 Work out what is needed to balance each scale.

a



b

c



d

2 Estimate the mass of each object.

10 g | 1000 g | 3500 kg | 20 kg | 250 g | 70 kg | 1000 kg

LIVEWORKSHEETS