Hanoi Adelaide School

BÀI 37
PHÉP NHÂN
(tiết 2)

LIVEWORKSHEETS

VÉ RA CỬA

LIVEWORKSHEETS

1 Viết phép nhân

a)

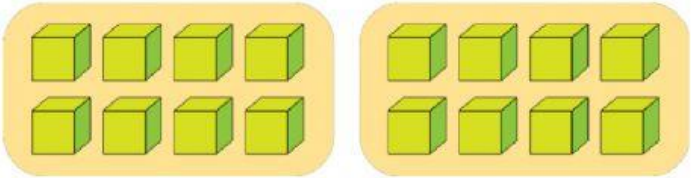

... x ...

b)

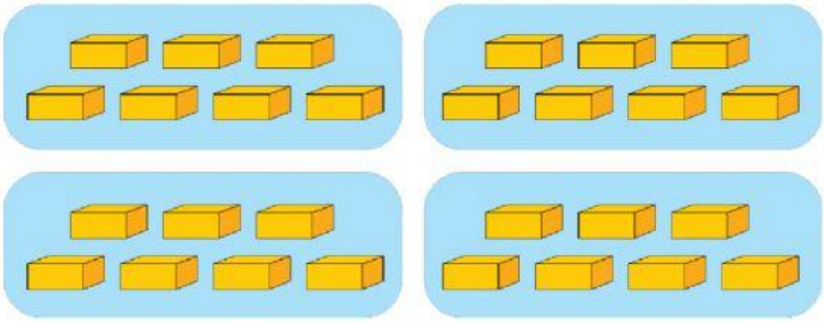

... x ...

LIVEWORKSHEETS

2 Viết phép nhân

Mẫu: 10 + 10 + 10 + 10 = 10 x 4 = 40

a) 7 + 7 + 7 + 7 + 7 = ... = ...

b) 9 + 9 + 9 = ... = ...

c) 4 + 4 + 4 + 4 + 4 + 4 = ... = ...

d) 10 + 10 + 10 + 10 + 10 = ... = ...

LIVEWORKSHEETS

3 Tính (theo mẫu):

a) 5 x 4

... + ... + ... + ... = ...

... x ... = ...

b) 2 x 5

... + ... + ... + ... + ... = ...

... x ... = ...

c) 8 x 2

... + ... = ...

... x ... = ...

d) 3 x 3

... + ... + ... = ...

... x ... = ...

LIVEWORKSHEETS

4 Tính để biết mỗi con chim sẽ bay đến cây nào?

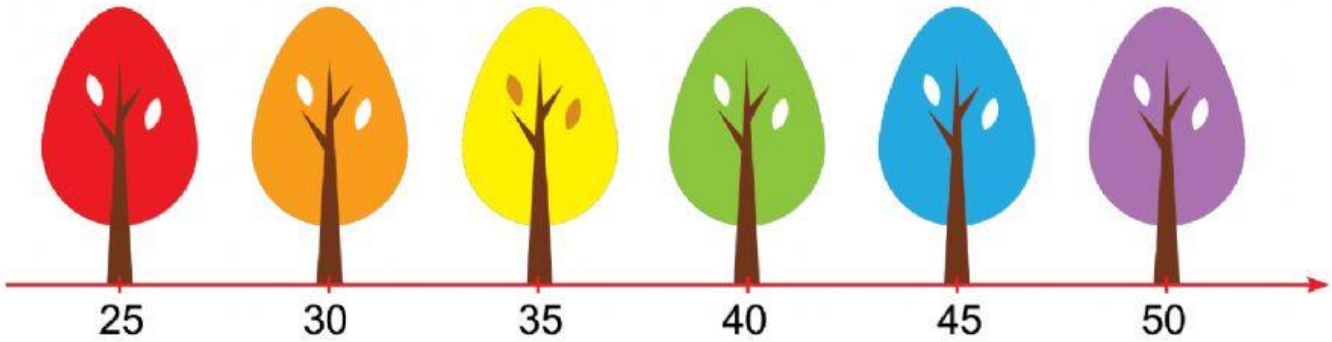

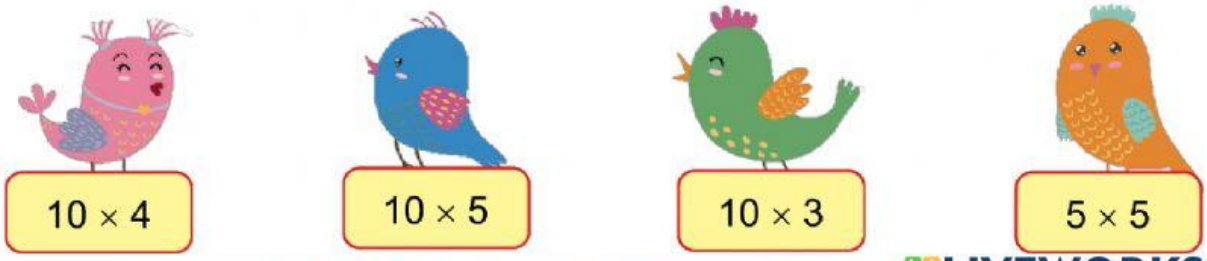

LIVEWORKSHEETS

5 Viết phép nhân

Mẫu:

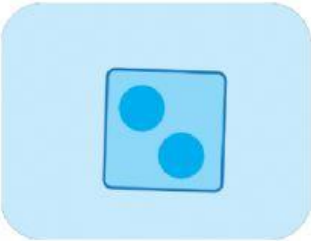

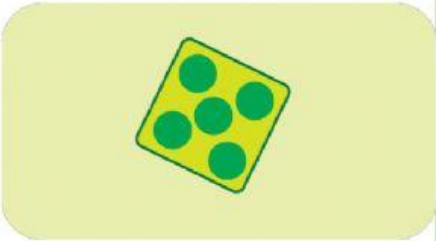

$3 \times 1 = 3$

... x ... = ... x ... = ...

3 được lấy 1 lần, ta viết:

LIVEWORKSHEETS