4. Round off each number to the nearest thousand.

(a) 1234 ≈ _____ (b) 6509 ≈ _____

(c) 19 505 ≈ _____ (d) 38 500 ≈ _____

(e) 70 604 ≈ _____ (f) 89 498 ≈ _____

5. Find the greatest and smallest possible values of each amount before it was rounded off to the nearest thousand. Use the number lines to help you.

Example

Osman saved about $14 000.

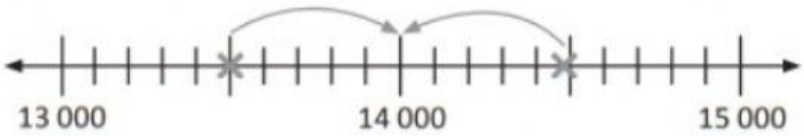

The greatest possible amount he saved is $ 14 499.

The smallest possible amount he saved is $ 13 500.

(a) There are about 25 000 known species of bees.

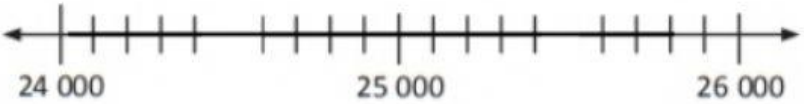

The greatest possible number of known species of bees is _____.

The smallest possible number of known species of bees is _____.

(b) Mr Khalid sold about 60 000 kg of fruits.

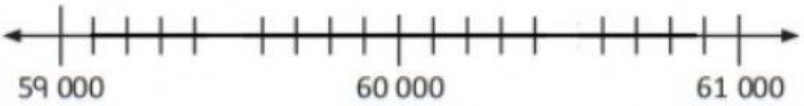

The greatest possible amount of fruits he sold is _____ ..g.

The smallest possible amount of fruits he sold is _____ kg.

LIVEWORKSHEETS