¿A qué fracción corresponde la parte coloreada? (X)

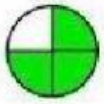

$\frac{4}{3}$ $\frac{3}{4}$ $\frac{1}{4}$

$\frac{4}{5}$ $\frac{1}{4}$ $\frac{1}{5}$

$\frac{2}{5}$ $\frac{3}{2}$ $\frac{3}{5}$

$\frac{5}{8}$ $\frac{3}{8}$ $\frac{5}{3}$

$\frac{1}{2}$ $\frac{2}{4}$ $\frac{4}{2}$

$\frac{2}{3}$ $\frac{3}{2}$ $\frac{1}{3}$

$\frac{1}{5}$ $\frac{5}{4}$ $\frac{4}{6}$

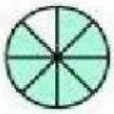

$\frac{1}{9}$ $\frac{7}{8}$ $\frac{9}{8}$

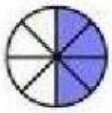

$\frac{4}{8}$ $\frac{1}{2}$ $\frac{8}{4}$

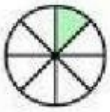

$\frac{8}{1}$ $\frac{1}{8}$ $\frac{1}{2}$

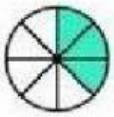

$\frac{3}{8}$ $\frac{1}{4}$ $\frac{5}{3}$

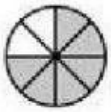

$\frac{3}{4}$ $\frac{2}{8}$ $\frac{6}{8}$