HOMEWORK MATHS 5 WEEK 19

NAME: **CLASS:**

1 Write the name of each triangle. Some triangles may have more than one name.

a)



b)

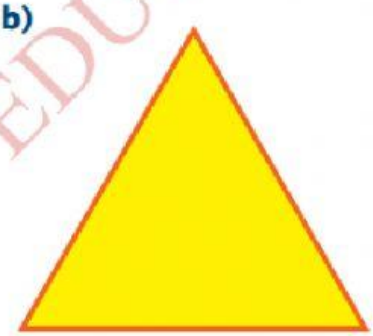

c)

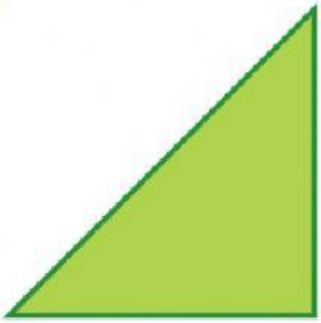

d)



e)

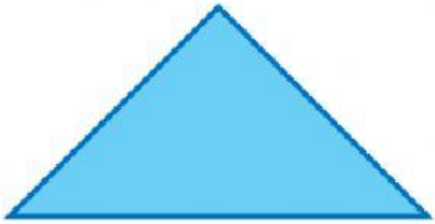

f)

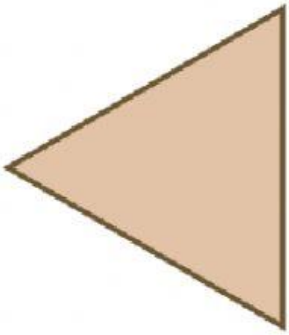

MACMILLAN EDUCA

LIVEWORKSHEETS

1 Write how many lines of symmetry there are on each of these shapes.

a)



b)

c)

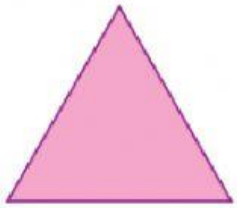

d)

e)

f)

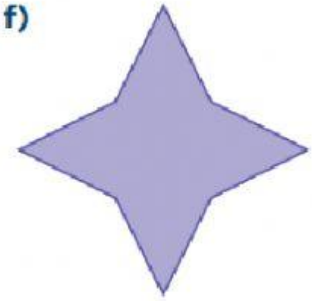

g)

h)

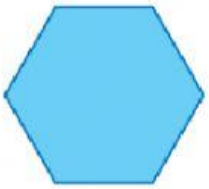

MACMILLAN EDUCATION CO

LIVEWORKSHEETS