Mathematics
Gr. 7

3.3 Subtract Integers

Warm Up

Map Question

Consider this equation.

$$x = 2.5 - (8)$$

Which of the following shows the value of x graphed on a number line?

Ⓐ 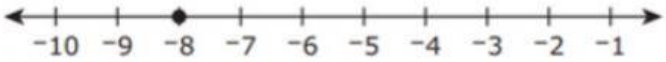

Ⓑ

Ⓒ 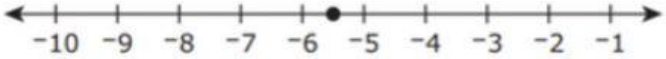

Ⓓ 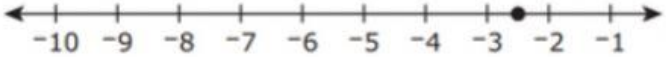

Outcomes

1. Subtract integers
2. Solve real-world problems involving integers

ADNOC School / Monday, Jan. 10/ 2022

Prepared by Murad

LIVEWORKSHEETS