BUỔI 14: ÔN TẬP

Bài 1: Điền vào dấu "....."

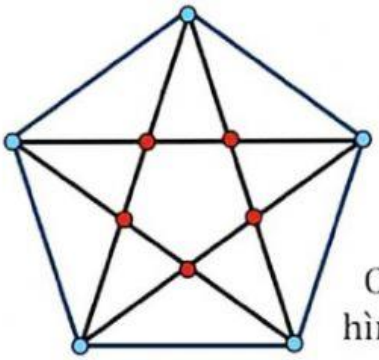

Có bao nhiêu hình Tam giác?

.....

Bài 2: Tính

24 : 2 = ... 36 : 3 = ... 96 : 3 = ...

122 : 2 = ... 105 : 5 = ... 123 : 3 = ...

249 : 3 = ... 340 : 5 = ... 214 : 2 = ...

Bài 3: Số?

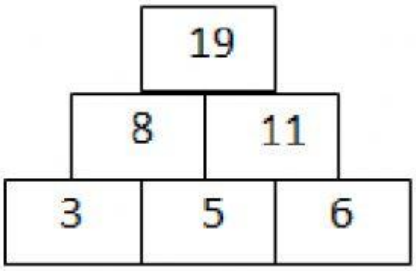

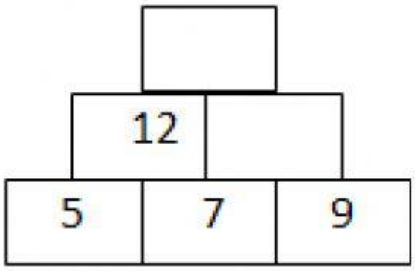

Bài 4: Tính

$$\begin{array}{r} 484 \\ -\ 241 \\ \hline \end{array} \qquad \begin{array}{r} 586 \\ -\ 253 \\ \hline \end{array} \qquad \begin{array}{r} 497 \\ -\ 125 \\ \hline \end{array} \qquad \begin{array}{r} 925 \\ -\ 420 \\ \hline \end{array}$$

LIVEWORKSHEETS