Наставен лист по Математика за II одделение
Тема: Мерење и решавање проблеми
Одредуваме збир на монети и банкноти до 100 денари
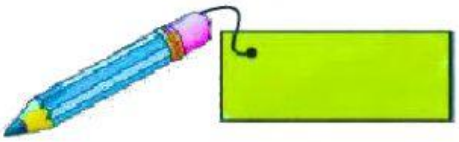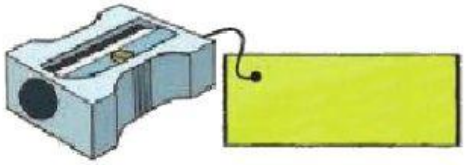
1 Запиши колку чини секој од предметите.