The grade one class went on a trip to the farm yesterday. Everyone had a great time!

Complete the word sums using the number lines:

a) There were 2 boys and 3 girls on the farm. How many children are there?

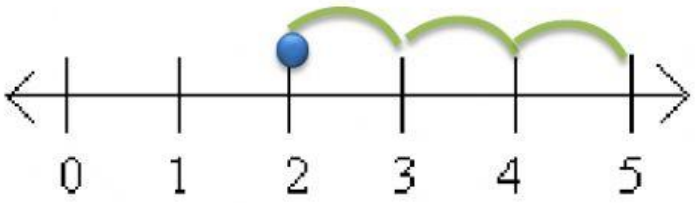

b) There was 1 horse and 3 chickens. How many animals were there?

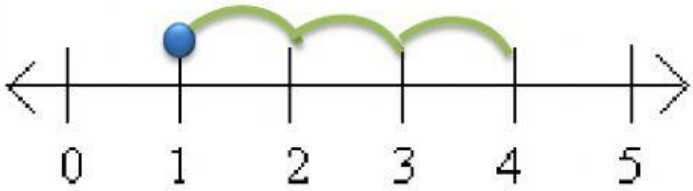

c) There was 1 farmer and 2 apple pickers. How many people work on the farm?

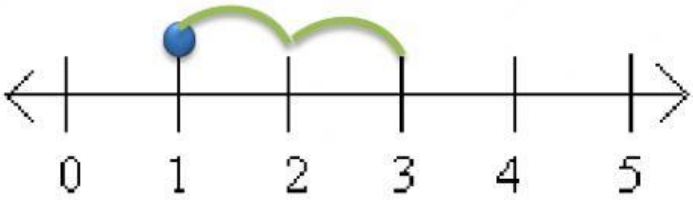

LIVEWORKSHEETS