Cambridge Assessment International Education

Cambridge International School

Cambridge Primary Programme

CAMBRIDGE PRIMARY MATHEMATICS 1

REVISION 1

Name: _____ Date: _____ Class: _____

Part 1. Look, read and match.

five

two

three

eight

one









LIVEWORKSHEETS

six



seven



nine



ten



LIVEWORKSHEETS

Part 2. Write the number that comes after.

2		5		8	

Part 3. Write the number that comes before.

	2		5		8

Part 3. Write the number that comes between.



Part 4. Look, read and tick (✓) the box.

1. Which is taller?



☐ ☐

2. Which is shorter?



☐ ☐

LIVEWORKSHEETS

3. Which is smaller?

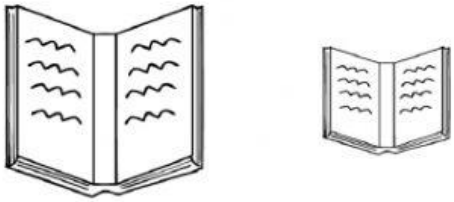

4. Which is the tallest?



5. Which is the smallest?

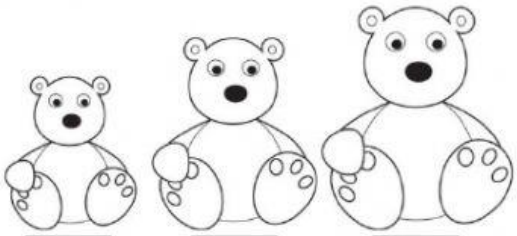

5. Which is the longest?



6. Which is the shortest?



LIVEWORKSHEETS

Part 5. Split these numbers into tens and ones.

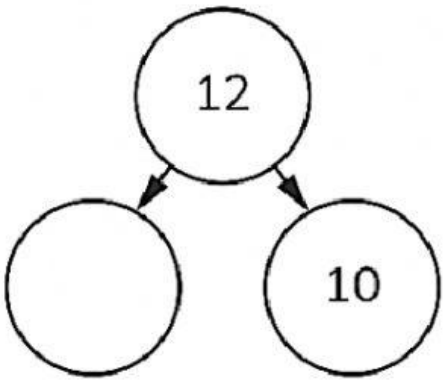

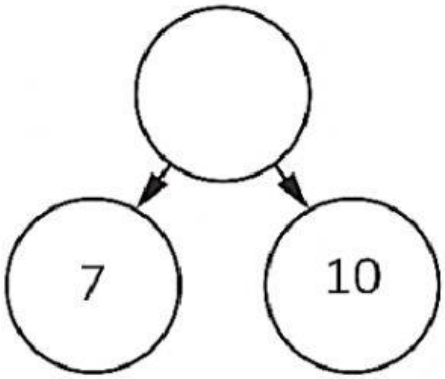

12 is made of ten and ____ ones.

____ is made of ten and 7 ones.

Part 6. Look and fill in the missing numbers.



Double 4 makes _____ .



Double 1 makes _____ .



Double 7 makes _____ .

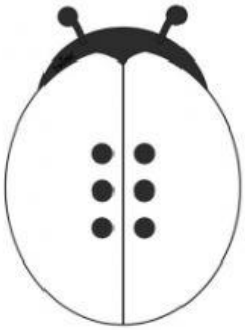

Double 3 makes _____ .

LIVEWORKSHEETS

Part 7. Fill in the missing numbers to find the number pairs to 8.

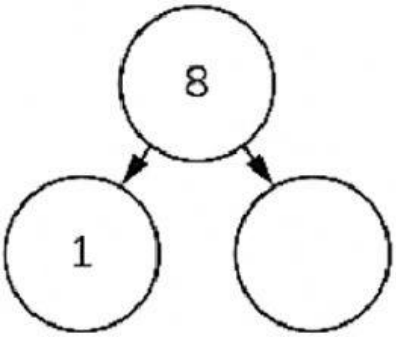

1 and _____ is a number pair to 8.

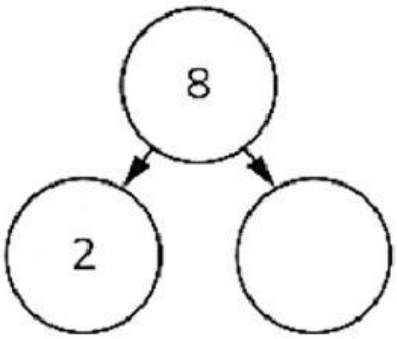

2 and _____ is a number pair to 8.

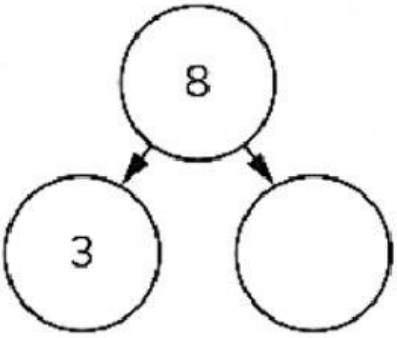

3 and _____ is a number pair to 8.

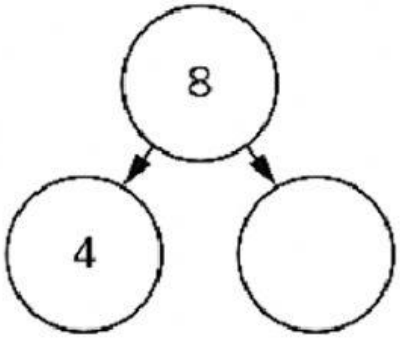

4 and _____ is a number pair to 8.

LIVEWORKSHEETS