4º

INSTITUCION EDUCATIVA PRIVADA
"SANTA MARIA DE FATIMA"
INICIAL Y PRIMARIA

Examen Geometría IV Bimestre

1. De la figura hallar "x"**(observa bien)**:

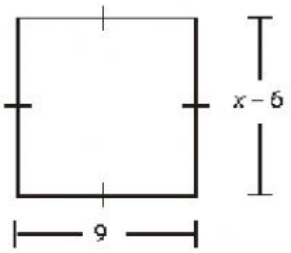

x =

2. Calcula el perímetro del cuadrado PQRS

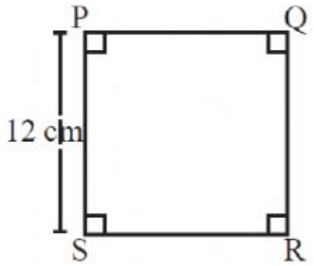

p =

3. Calcular "α" en el rombo**(observa bien)**:

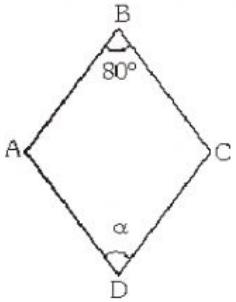

α =

4. Hallar el valor de "θ" en el trapecio:

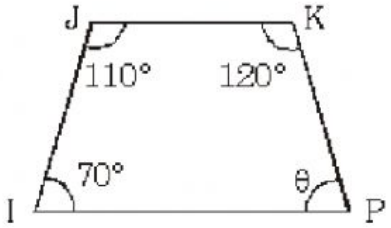

θ =

5. Hallar el valor de "θ"

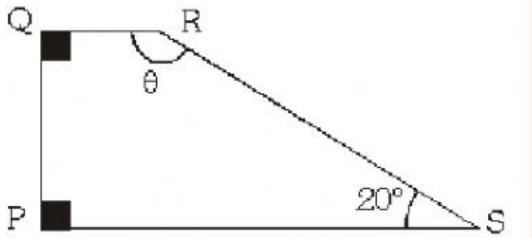

θ =

LIVEWORKSHEETS

6. Relaciona:

Área del triángulo	$A_{\square} = a.b$
Área del cuadrado	$A_{\Delta abc} = \frac{b.h}{2}$
Área del rectángulo	$A_{\square} = a^2$

7. Hallar el área del siguiente triángulo:

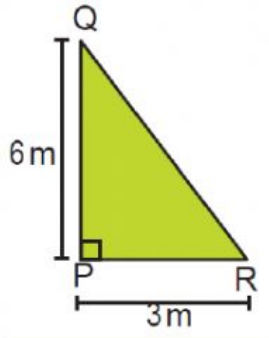

Area =

8. Calcula el área del romboide :

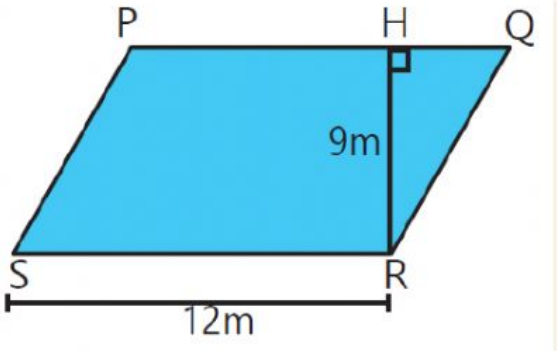

Area =

LIVEWORKSHEETS