TAULER NUMÈRIC DE LA CENTENA

1. Operació

450+550=

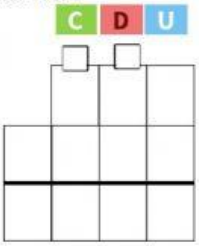

2. Completa la sèrie

3. Escrivim el número

4. Contruïm amb blocs



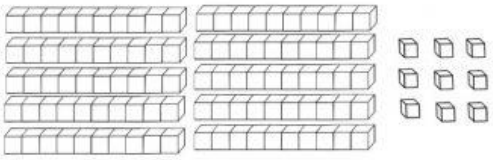

5. Descomposició

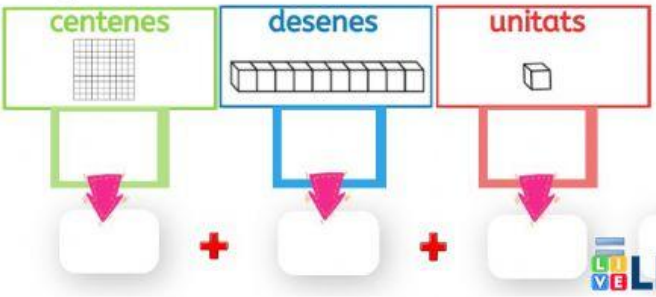

LIVEWORKSHEETS

TAULER NUMÈRIC DE LA CENTENA

1. Operació

135+328=

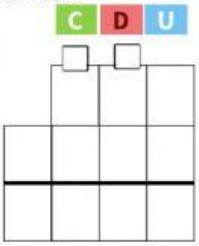

2. Completa la sèrie

3. Escrivim el número

4. Contruïm amb blocs



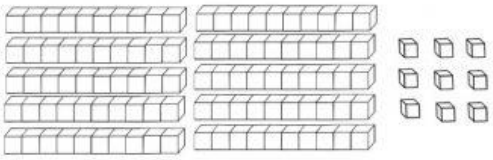

5. Descomposició

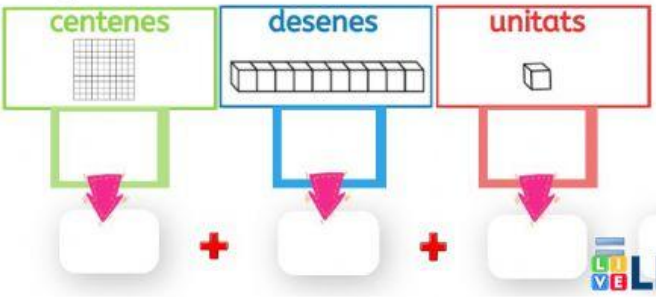

LIVEWORKSHEETS

TAULER NUMÈRIC DE LA CENTENA

1. Operació

273-122=

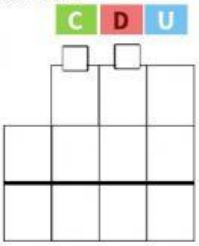

2. Completa la sèrie

3. Escrivim el número

4. Contruïm amb blocs



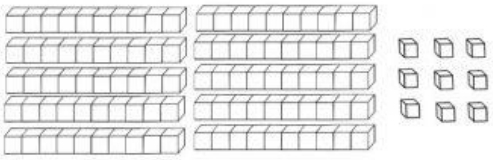

5. Descomposició

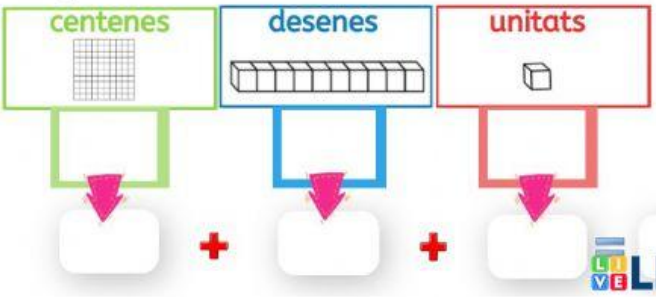

LIVEWORKSHEETS

TAULER NUMÈRIC DE LA CENTENA

1. Operació

215+487=

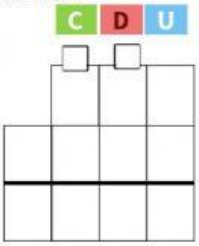

2. Completa la sèrie

3. Escrivim el número

4. Contruïm amb blocs



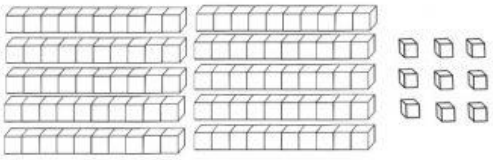

5. Descomposició

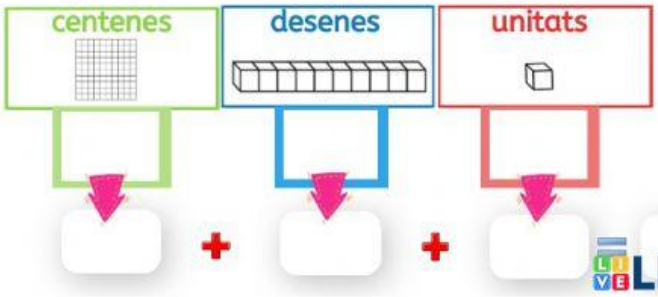

LIVEWORKSHEETS

TAULER NUMÈRIC DE LA CENTENA

1. Operació

159-34=

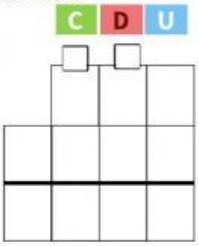

2. Completa la sèrie

3. Escrivim el número

4. Contruïm amb blocs



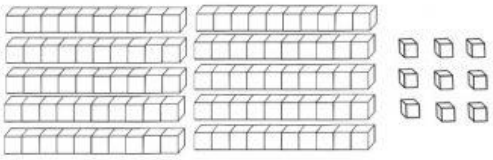

5. Descomposició

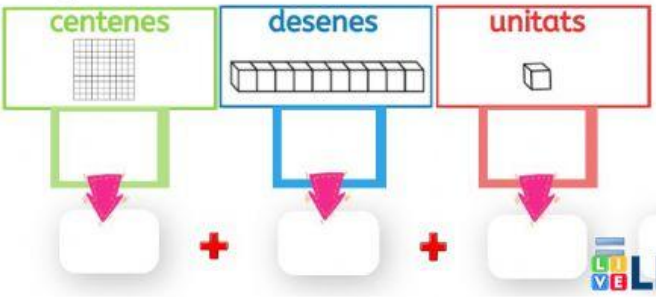

LIVEWORKSHEETS