LET'S REVIEW

+ - x :

Continue the number sequence.

300	303						321
400	404						428
500	505						535
600	606						642
700	707						749

Write the expression and solve it vertically. Circle the answer.

a. There were 657 slices of bread in the school canteen. On Monday, the pupils ate 275 slices and on Tuesday, 280 slices. How many slices were left in the canteen?

_____

Answer: _____

b. The canteen made 150 portions of pea soup. During the first sitting, the pupils ate 38 portions and during the second sitting, 47 portions. How many portions were left for the third sitting?

_____

Answer: _____

c. There were 327 clean plates in the canteen, and 158 of them were used. Then, 75 more clean plates were brought in. How many clean plates were now available in the canteen?

_____

Answer: _____

LIVEWORKSHEETS

Work out what numbers the pictures represent.

a.





b.



Write the expression and calculate the price of the purchases. Circle the answer.

a. Emma buys four soft toys.

_____

Answer: _____

b. Lewis's father buys four sledges.

_____

Answer: _____

c. The teacher buys three pairs of skates.

_____

Answer: _____

d. Ann's father buys two skateboards

_____

Answer: _____

e. Anthony buys six Lego packs.

_____

Answer: _____

LIVEWORKSHEETS

5. A classroom is arranged with five tables of four places, and a row of nine places. How many places are there in the classroom?

6. Phil saw 3 reb birds and 5 times as many blue birds. How many birds did he see in all?



. Practise mental arithmetic.

a. How many ponies at most can you buy with 25 euros?

ponies

b. How many toy cars at most can you buy with 48 euros?

c. How many balls at most can you buy with 20 euros?

d. How many soft toys at most can you buy with 30 euros?

d. How many skipping ropes at most can you buy with 15 euros?

LIVEWORKSHEETS