PRISMAS

PIRÁMIDES

1. Completa con los elementos de cada figura:

vértice | cara

vértice | cara

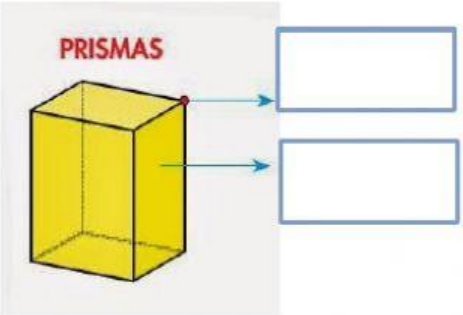

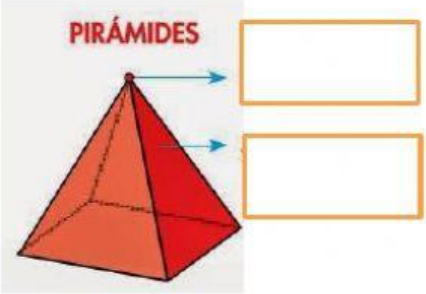

2. Une con flechas.

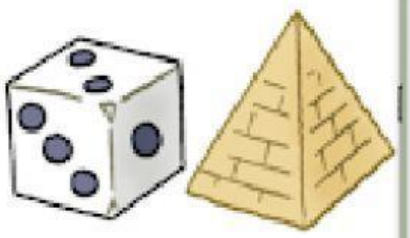

PRISMA

PIRÁMIDE

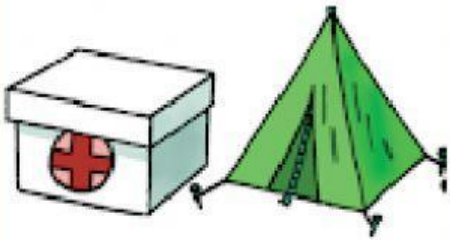

PRISMA

PIRÁMIDE



PRISMA

PIRÁMIDE