15. Xăng-ti-mét

1. *Tích (✓) vào cách đo đúng.*



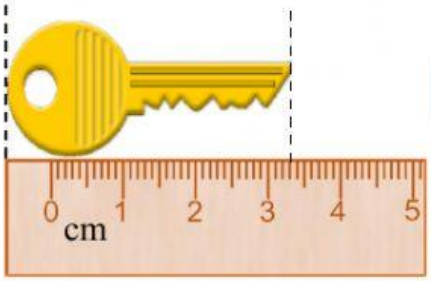

*Viết số **đo độ dài** của mỗi con vật sau.*

2.

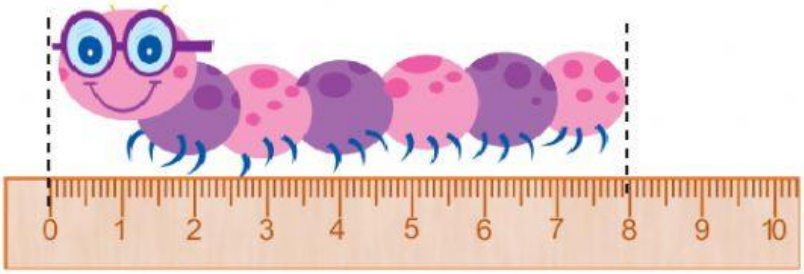

___ cm

3.

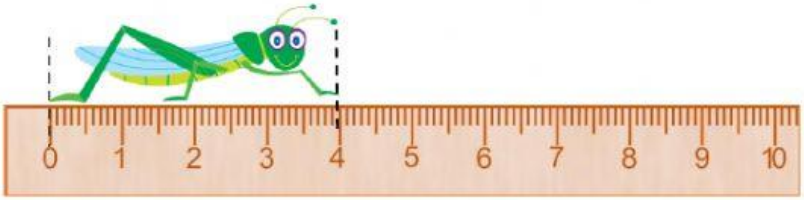

___ cm

Nối

4.

9 cm

5.

1 cm

6.

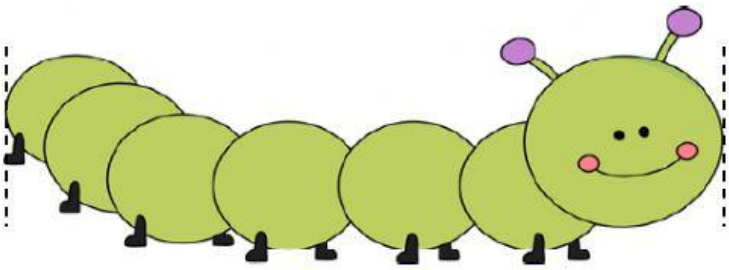

3 cm

LIVEWORKSHEETS