Tên:

Lớp

Câu 1: Số ?





Câu 2: >, <, = ?



LIVEWORKSHEETS

Câu 3: Tính:

=

=

=

=

Câu 4: Nối sơ đồ tương ứng với tranh:





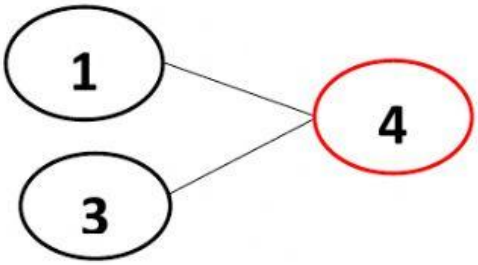

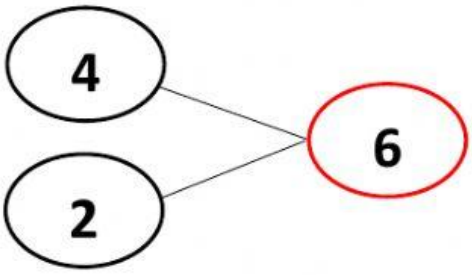

Câu 5: Số?

a. Có hình dạng khối hộp chữ nhật.

b. Có hình dạng khối lập phương.

LIVEWORKSHEETS