More Addition Sentences

1	2	3	4	5	6	7	8	9	10

1 Write a number sentence for each set.

a

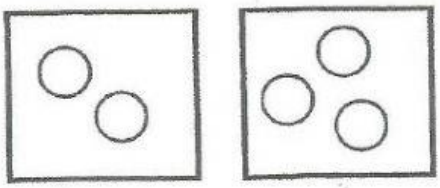

___ + ___ = ___

b

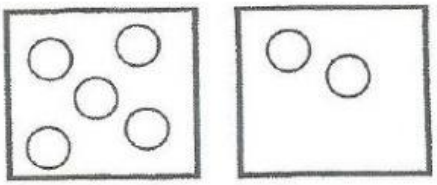

___ + ___ = ___

c

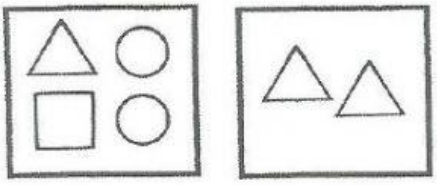

___ + ___ = ___

d

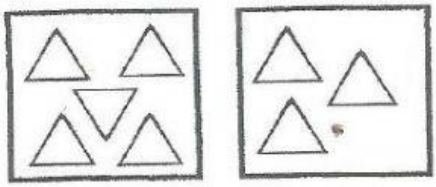

___ + ___ = ___

e

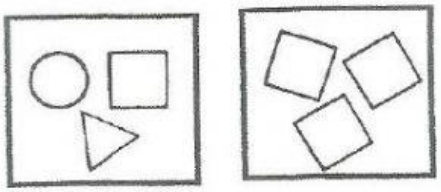

___ + ___ = ___

f

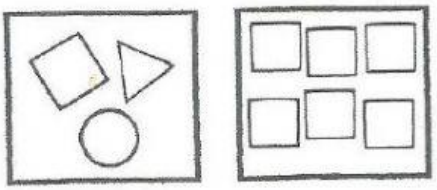

___ + ___ = ___

g

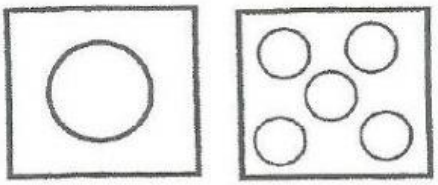

___ + ___ = ___

h

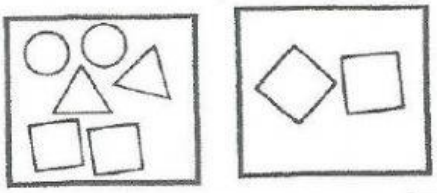

___ + ___ = ___

LIVEWORKSHEETS