IE. 3079 "Nuestra Señora de las Mercedes"

APRENDO en casa

Calculamos el Perímetro y Área de la figura plana correspondiente

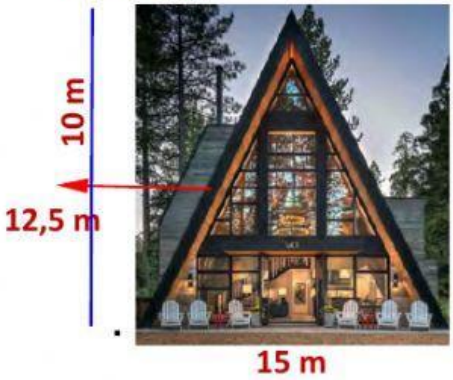

P=_____m

A=_____m^2

P=_____m

A=_____m^2

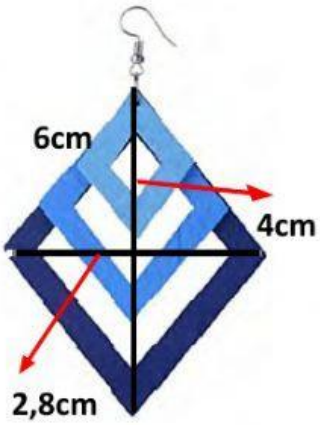

P=_____cm

A=_____cm^2

P=_____m

A=_____m^2

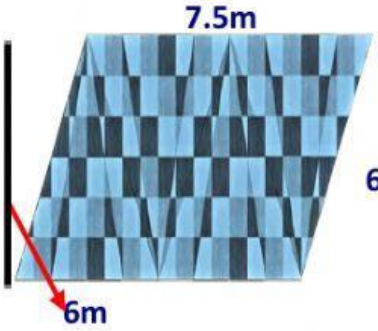

P=_____m

A=_____m^2



P=_____m

A=_____m^2

LIVEWORKSHEETS