Matemáticas divertidas

Familia del 1 al 30

1. Completa la casita de la familia del 10, colocando los números en el orden correcto inicia en la flecha.

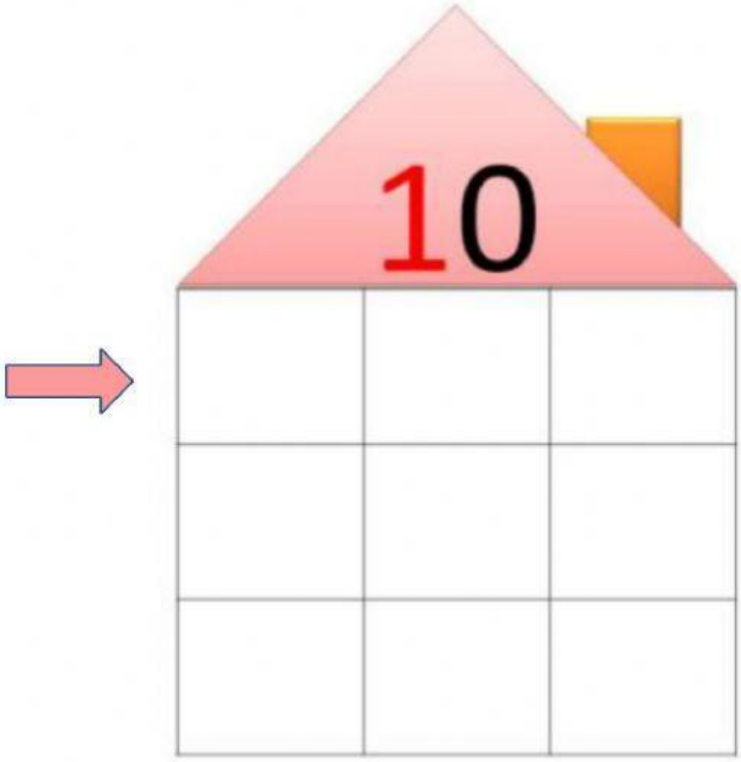

16 12 19 14

18 13 17 11 15

LIVEWORKSHEETS

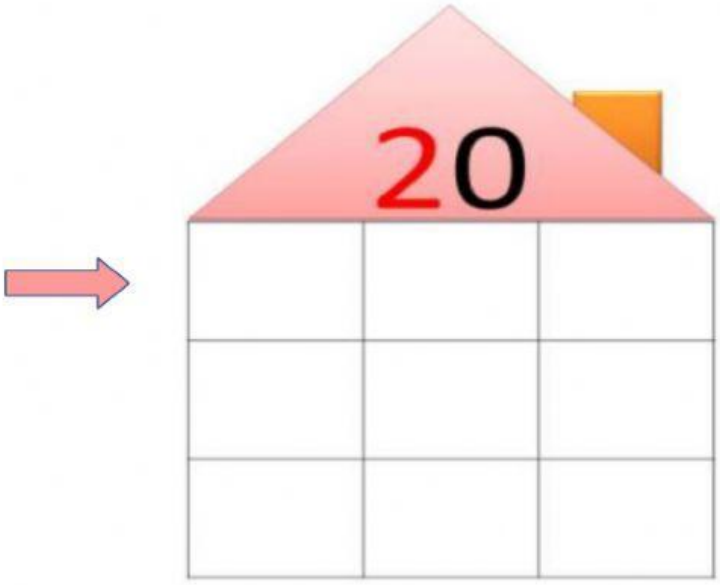

25 22 28 23

26 21 27 29 24

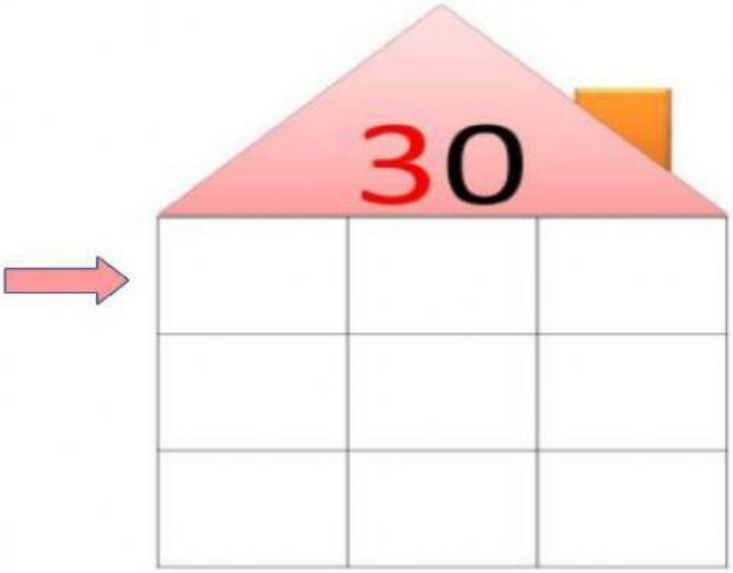

33 38 35 39

37 31 36 32 34

LIVEWORKSHEETS

2. Completa la siguiente tabla con los números que faltan. Repite la numeración en voz alta.

1					6				10
		13	14				18		
	22			25				29	

3. Realiza conteo de 2 en 2. Escribe los números para completar la serie.

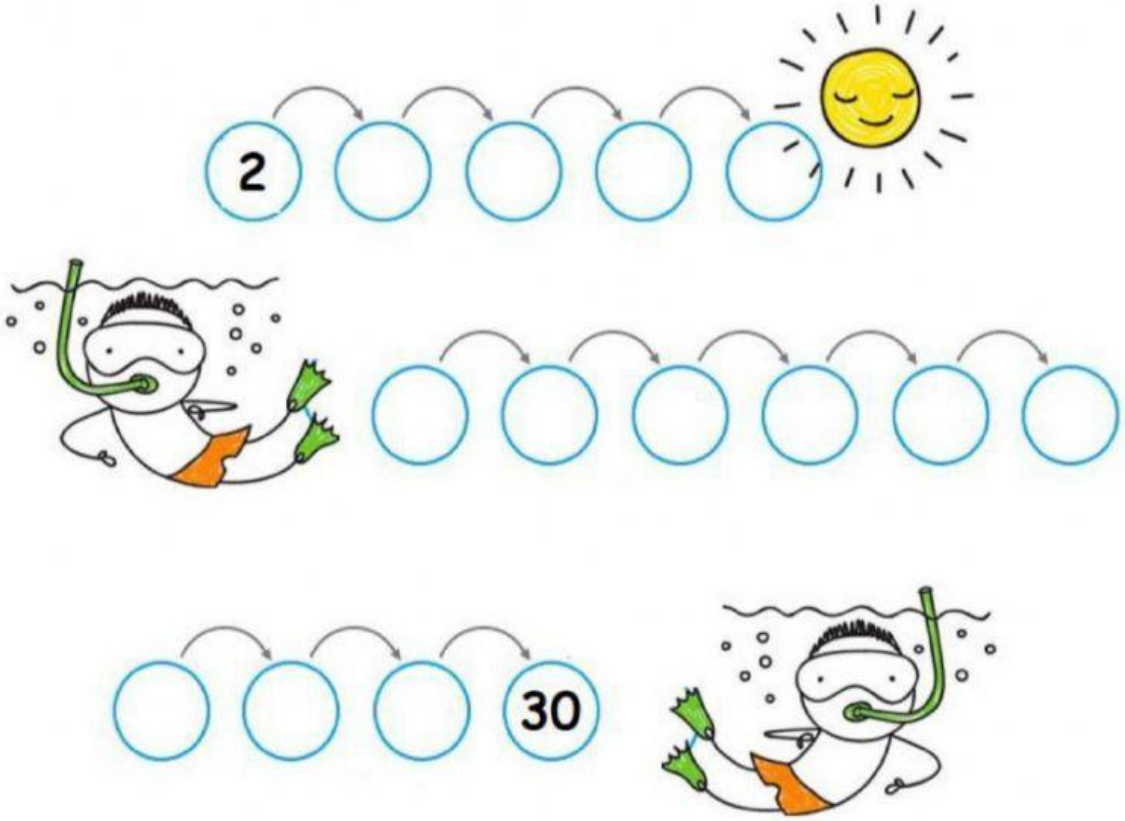

LIVEWORKSHEETS

4. Ordena cada serie numérica de forma descendente. Coloca el número donde corresponde

15 8 27 32 11 22

☐ - ☐ - ☐ - ☐ - ☐ - ☐

24 19 5 37 9 23

☐ - ☐ - ☐ - ☐ - ☐ - ☐

Observa la imagen y realiza las siguientes actividades.

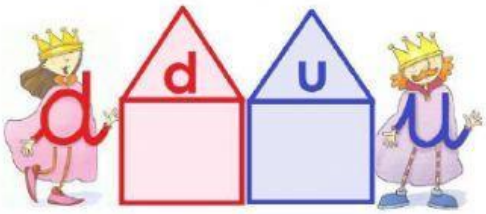

LIVEWORKSHEETS

5. Coloca los números en la casita de valores

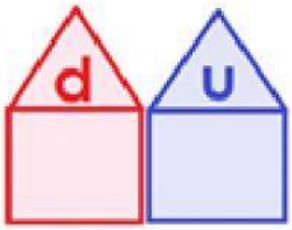

7

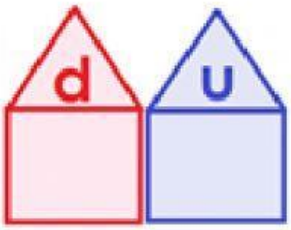

18

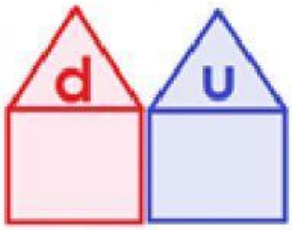

36

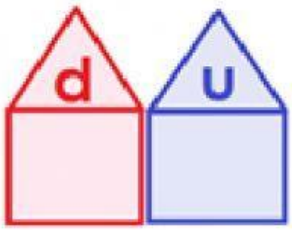

22

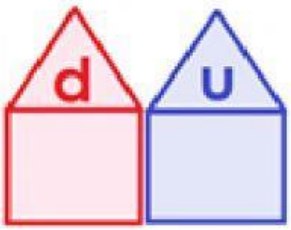

34

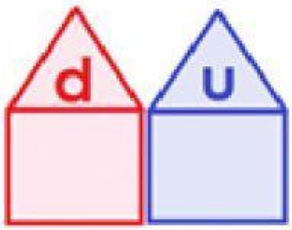

16

5. Une cada número con su escritura en palabras.

30	veintinueve
17	treinta
29	diecinueve
20	diecisiete
19	veinte

LIVEWORKSHEETS

6. Escribe el número que representa cada representación gráfica.





TIEMPO DE DESAFIO

Ahora te desafío en tu libreta de matemáticas escribe la numeración del 1 al 30 de manera ascendente y después de manera descendente.

Miss Laura

LIVEWORKSHEETS