NOME: _____

METADE

Você irá obter a metade de uma quantidade dividindo o número por 2.

Veja o exemplo abaixo:



A metade de 6 é 3.

6 ÷ 2 = 3

Dê a metade das quantidades abaixo:



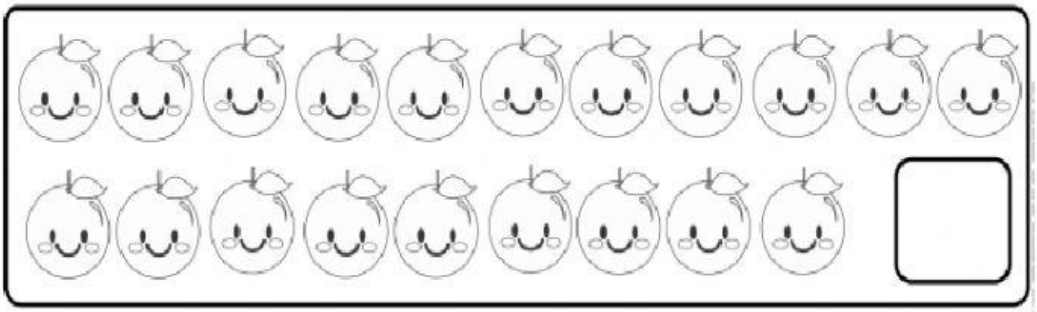

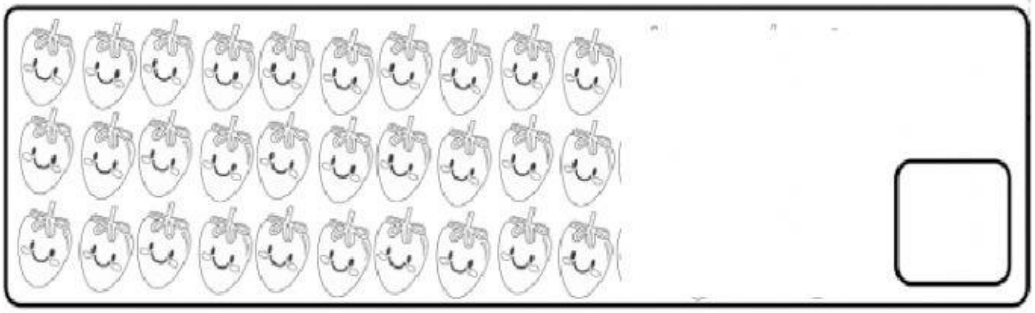

LIVEWORKSHEETS

I) BINHO E JULINHO COMERAM A METADE DOS 8 BISCOITOS QUE ESTAVAM EM CIMA DA MESA. QUANTOS BISCOITOS ELES COMERAM:

HAVIAM _____ BISCOITOS NA MESA.

ELES COMERAM _____ BISCOITOS.

NO TOTAL, SOBRARAM _____ BISCOITOS.

OITO É O DOBRO DE _____.

_____ É A METADE DE OITO.

I) HÁ UMA ÚNICA FIGURA CUJA PARTE PINTADA CORRESPONDE EXATAMENTE A SUA METADE. MARQUE UM X NA RESPOSTA CORRETA.



MARQUE COM UM X A METADE DAS QUANTIDADE E COMPLETE.



A metade de 8 é _____

A metade de 4 é _____



A metade de 2 é _____



A metade de 6 é _____

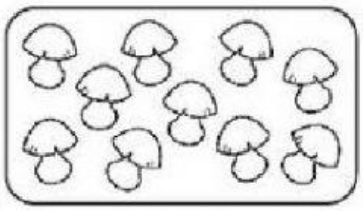

A metade de 10 é _____



A metade de 12 é _____

LIVEWORKSHEETS