Subtraction

3 – 1 =____

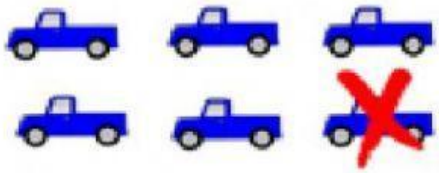

6 – 1 =____

4 – 1 =____

9 – 1 =____



7 – 1 =____

---

8 5 2 3 6

LIVEWORKSHEETS

Directions: Write the number model to match each subtraction picture.

_____ – _____ = _____

_____ – _____ = _____

_____ – _____ = _____



_____ – _____ = _____



_____ – _____ = _____

LIVEWORKSHEETS