NAME:

_____

NO.	ITEMS
1.	**Write the expanded form for 125.** **125 = _____ + _____+ _____** **= _____**
2.	**What is the value of the 1 in the number below?** **126** **Answer: _____**
3.	**Write in words** **$348.00** **Answer: _____** **_____ dollars**
4.	**Round off 21 to the nearest tens.** 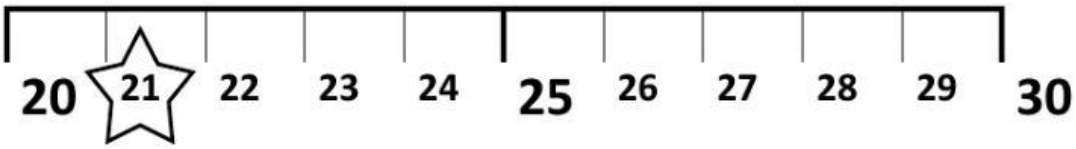 **Answer: _____**

LIVEWORKSHEETS

5. Write in figures

Three thousand, six hundred and thirty-nine.

Th	H	T	O

Answer: _____

6. Insert the correct sign below to complete the statement.

More than	Less than	Equal to
>	<	=

102 [ ] 322

7. Arrange the following numbers in <u>descending order.</u>

488, 025, 348, 226

Answer: _____

8. Write the value of:

(9x100) + (5x10) + (6x1) = _____

9. Write the numeral for

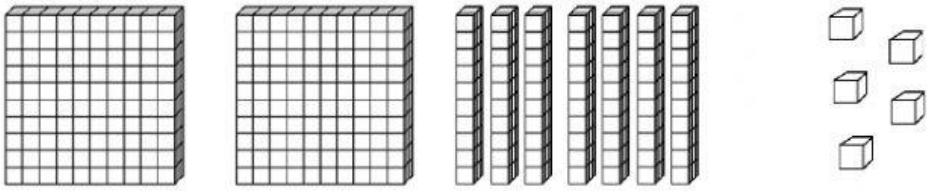

Answer: _____

LIVEWORKSHEETS

10. What is the <u>VALUE</u> of the **6** in the numeral **106**?

Answer: _____

11. The diagram below shows part of a calendar for November.

NOVEMBER 2020						
SUN	MON	TUE	WED	THU	FRI	SAT
1	2	3	4	5	6	7
8	9	10	11	12	13	14
15	16	17	18	19	20	21
22	23	24	25	26	27	28
29	30					

www.theprintablecalendar.com

What is the date of the 2nd Monday of the month?

Answer: _____

12. Write in the missing digit.

$$\begin{array}{r} 8\ \ 2 \\ +\ \ 1\ \ 7 \\ \hline 9\ \ \square \\ \hline \end{array}$$

LIVEWORKSHEETS

13.	**Use the benchmark number to help you decide which estimate is more reasonable. Tick your choice.** **5 flowers** ☐ **10 flowers or** ☐ **More than 10 flowers** 
14.	**Insert one of the signs below to make the statement correct.** **>, <, =** **43 + 21** ☐ **6 x 6** _____ _____
15.	**Solve the following.** 9 5 + 0 4 _____ _____

LIVEWORKSHEETS

16. **Find the sum of 59 and 20.**

	T	O
+		

17. **Calculate the product of 12 and 7.**

	X		=	

18. **Nick wants 30 marbles. He has 10. How many more marbles does he need to get?**

Answer: _____

LIVEWORKSHEETS

19.	**Alice has 25 pencils. Her friend gave her 13 more. How many pencils did she have now?**

	T	O
+		

20. **A car has 4 wheels. How many wheels will 9 cars have?**

☐ X ☐ = ☐

21. **Each chair has 4 legs. There are 7 chairs in a classroom. How many legs will there be in 7 chairs?**

☐ X ☐ = ☐

LIVEWORKSHEETS

22.	***Round off*** **the two numbers to the nearest tens and** ***then add*** **21 + 16 = _____** **{ } + { } = _____**
23.	**Lisa bought a pair of scissors for $3.00, a ruler for $2.00, and a pack of marks for $12.00. How much money did she spend in all?** **$3.00** **$2.00** **$12.00** **Answer: _____**
24.	**Name the shapes:**   **_____** **_____** **_____**

LIVEWORKSHEETS

25. **Lena shared 36 slices of pizzas equally among her 12 friends. How many slices of pizzas did each friend get?**



_____ into____ = _____

Each friend got _____ slices of pizzas.

26. **The chart below shows the flowers children liked in a standard two-class.**

Flowers	No. of children
Roses	**16**
Zinnia	**2**
Marigold	**21**
Sunflower	**15**

a) How many children liked sunflower? _____

b) How many more children liked roses than zinnia?

_____

LIVEWORKSHEETS