Sains Tahun 4 Nama :_____ 25.11.2021

Tajuk : Sifat Cahaya [Cahaya Bergerak Lurus]

Arahan : Tuliskan jawapan di ruang yang disediakan.

1. Antara lakaran berikut yang manakah mewakili pergerakkan cahaya?

A

B

C

D 

2. Rajah 1 menunjukkan satu penyiasatan.

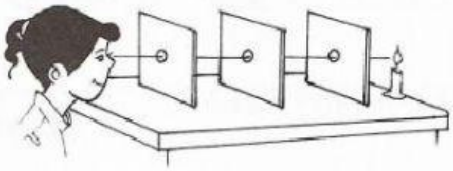

Rajah 1

Apakah sifat cahaya yang dikaji?

A cahaya boleh dipantul
B cahaya bergerak lurus
C cahaya boleh dibiaskan
D cahaya tidak boleh melalui objek legap

3. Antara situasi berikut, yang manakah menunjukkan cahaya bergerak lurus?

A 

B

C 

D 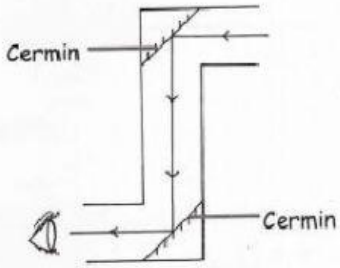

LIVEWORKSHEETS