Exercise Name:-_____

1) The bearing of A from B is 075° Find the Bearing of B from A.

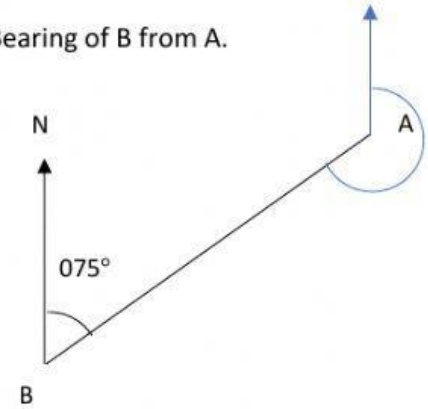

Bearing of B from A is _____ °

2) The bearing of P from Q is 240° Find the Bearing of Q from P.

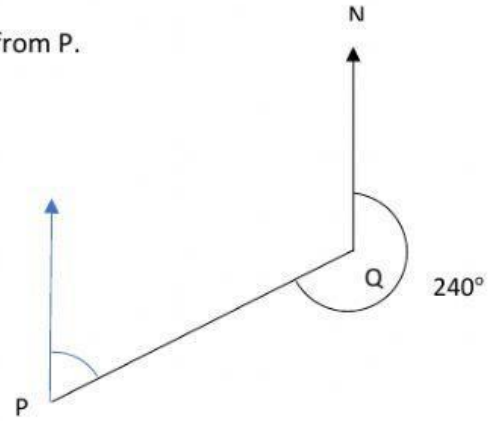

Bearing of Q from P is _____ °

3) The bearing of F from G is 155° Find the Bearing of G from F.

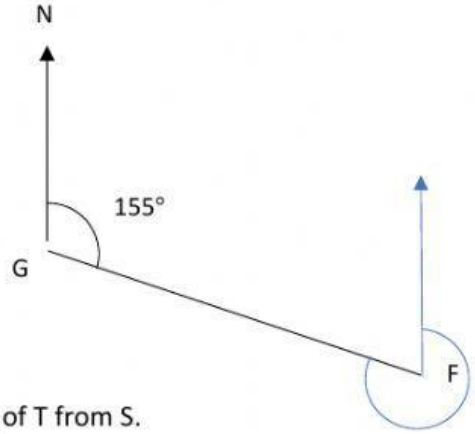

Bearing of G from F is _____ °

4) The bearing of S from T is 302° Find the Bearing of T from S.

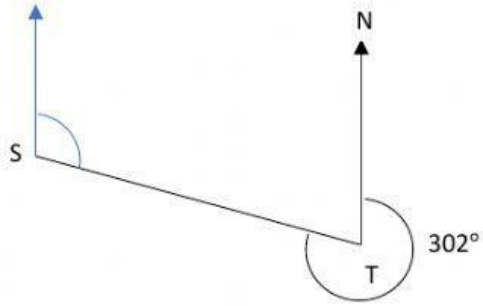

Bearing of T from S is _____ °

LIVEWORKSHEETS