➢ *Une cada figura con su perímetro correspondiente.*

20 cm

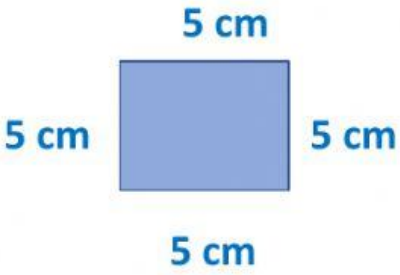

14 cm

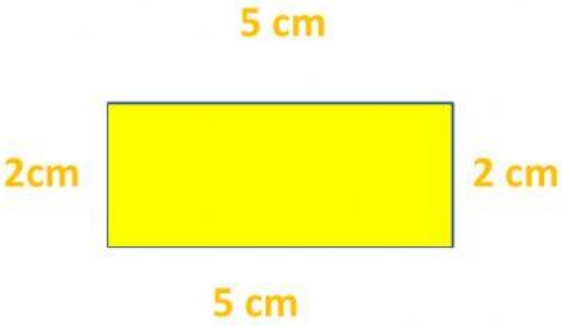

10 cm

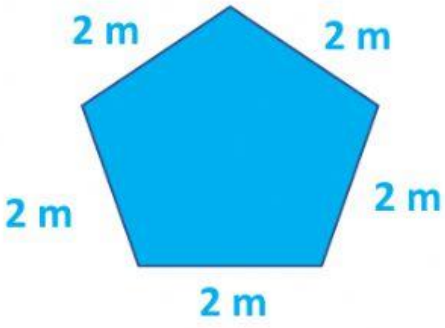

9 cm

LIVEWORKSHEETS
LIVEWORKSHEETS

PERIMETRO

"Es la suma de los lados de una figura geométrica, es la medida de su contorno".

P=L+L+L+L

CUADRADO

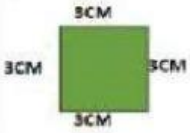

P=3cm+3cm+3cm+3cm

P= 12cm

RECTÁNGULO

P= 7cm+20cm+7cm+20cm

P= 54cm

- Calcula el perímetro de cada cuadrado:

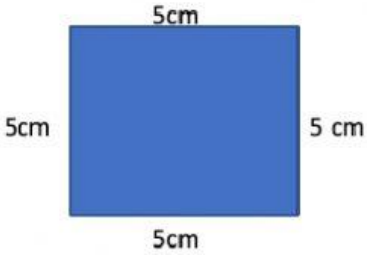

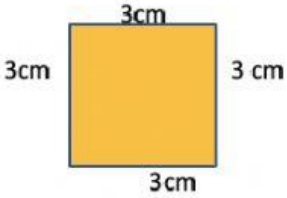

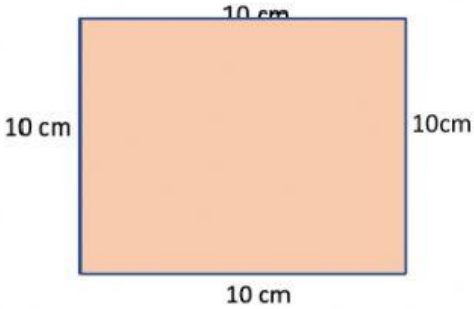

P = ☐ + ☐ + ☐ + ☐ **P =** ☐ + ☐ + ☐ + ☐ **P =** ☐ + ☐ + ☐ + ☐

P = ☐ P = ☐ P = ☐

- Calcula el perímetro de cada rectángulo:

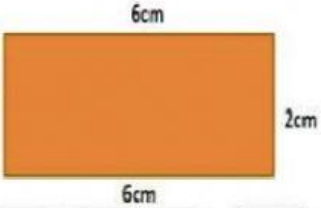

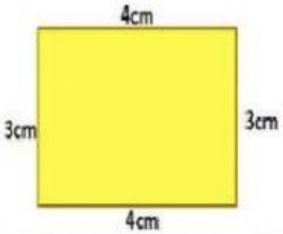

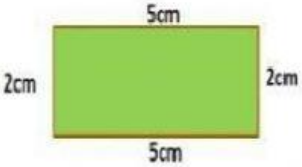

P=____+____+____+____ P=____+____+____+____ P=____+____+____+____

P=_____ P=_____ P=_____

LIVEWORKSHEETS

Desafío

Resuelve el siguiente problema:

Una parcela tiene forma de triángulo, y sus lados miden 9 m, 11 m y 12 m. Calcula cuantos metros de valla hacen falta para cercarla.

Solución: Hacen falta _____ metros.

LIVEWORKSHEETS