Observa y ordena.

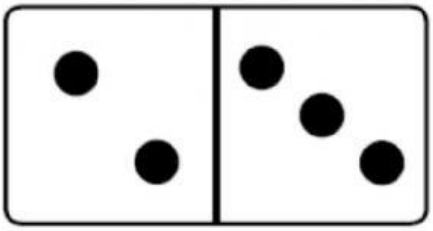

☐ + ☐ = ☐



☐ + ☐ = ☐



☐
+ ☐
☐



☐
+ ☐
☐

❷ Cuenta los jarrones y completa.

☐ y ☐ son 10.

☐ y ☐ son 10.

☐ y ☐ son 10.

☐ y ☐ son 10.

LIVEWORKSHEETS