ชื่อ - สกุล..... ชั้น..... เลขที่.....

ให้นักเรียนหาผลหารและเศษ โดยการหารยาว

1. 22 ÷ 5 = □

<u>วิธีทำ</u>

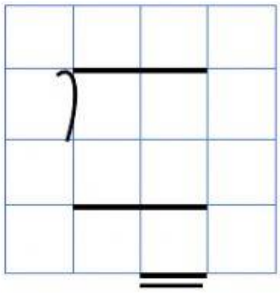

<u>ตอบ</u> .....

2. 40 ÷ 7 = □

<u>วิธีทำ</u>

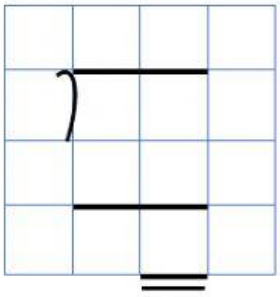

<u>ตอบ</u> .....

3. 29 ÷ 3 = □

<u>วิธีทำ</u>

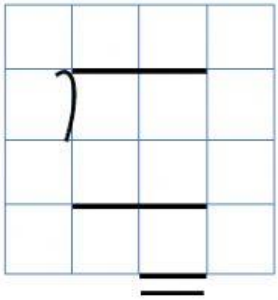

<u>ตอบ</u> .....

4. 30 ÷ 4 = □

<u>วิธีทำ</u>

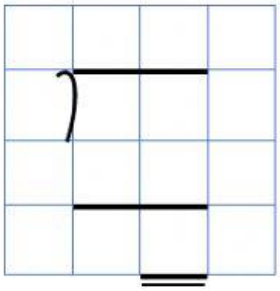

<u>ตอบ</u> .....

LIVEWORKSHEETS

5. 34 ÷ 10 = □

<u>วิธีทำ</u>

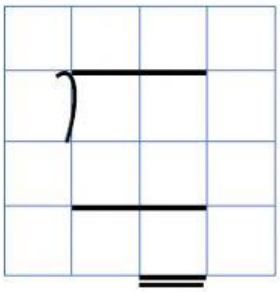

<u>ตอบ</u> .....

6. 28 ÷ 6 = □

<u>วิธีทำ</u>

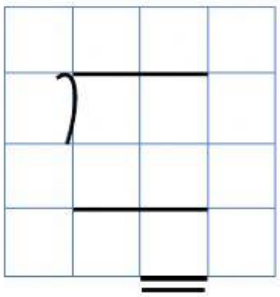

<u>ตอบ</u> .....

7. 48 ÷ 9 = □

<u>วิธีทำ</u>

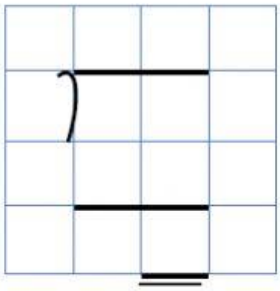

<u>ตอบ</u> .....

8. 88 ÷ 12 = □

<u>วิธีทำ</u>

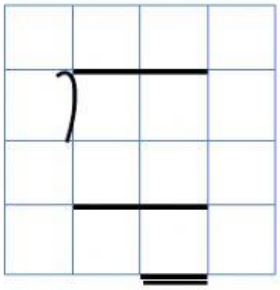

<u>ตอบ</u> .....

9. 42 ÷ 11 = □

<u>วิธีทำ</u>

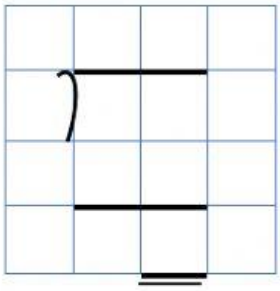

<u>ตอบ</u> .....

10. 51 ÷ 8 = □

<u>วิธีทำ</u>

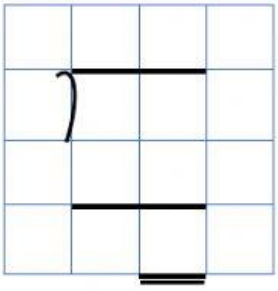

<u>ตอบ</u> .....

LIVEWORKSHEETS