SOLVE

Activity 1

1. Tick (✓) the suitable model.

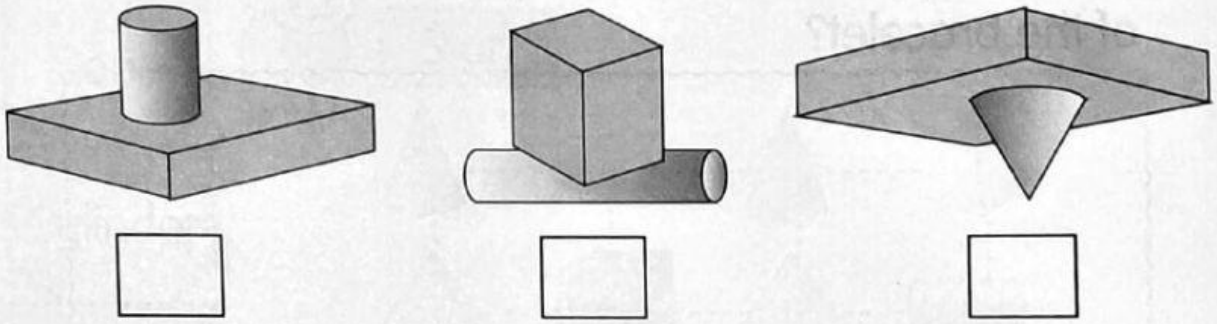

2. The shape has 4 corners. All its straight side is equal. What is the shape?

3. Raju wants to build a cube frame using the straws. How many straws does he need?

LIVEWORKSHEETS

4 Sima made a bracelet with beads as shown below.



What do you think is the shape of the eleventh bead of the bracelet?

5 Elisa buys food in a cuboid container.

a Tick (✓) the food that she possibly buys.



b Name the 2-D shape that forms when she traces the container.

LIVEWORKSHEETS