- Triangolo o quadrilatero? Scegli per ciascuna figura la risposta corretta



△ Triangolo
□ Quadrilatero

△ Triangolo
□ Quadrilatero



△ Triangolo
□ Quadrilatero



△ Triangolo
□ Quadrilatero



△ Triangolo
□ Quadrilatero

△ Triangolo
□ Quadrilatero

△ Triangolo
□ Quadrilatero

△ Triangolo
□ Quadrilatero

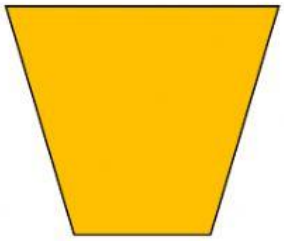

△ Triangolo
□ Quadrilatero



△ Triangolo
□ Quadrilatero

LIVEWORKSHEETS