Mathematics Homework



Solid Figures (3DShapes)

Total(13pts)

Instructions: Draw the line from each solid shape to its name.

sphere

cube

cone

rectangular prism

pyramid

cylinder

Select the objects that can roll.



Select the objects that can stack.

Which object can **not** slide ?

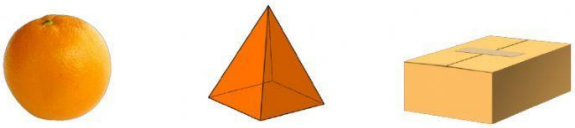

LIVEWORKSHEETS