ESCOLA: _____

NOME: _____

DATA: _____/_____/_____

☐ SEGUNDA ☐ TERÇA ☐ QUARTA ☐ QUINTA ☐ SEXTA

Pinte as partes de acordo com cada fração:

$\frac{3}{4}$		$\frac{1}{3}$	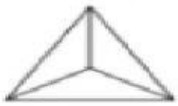
$\frac{1}{2}$		$\frac{5}{8}$	
$\frac{1}{4}$		$\frac{3}{6}$	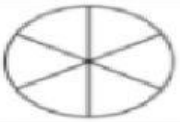
$\frac{2}{8}$	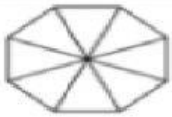	$\frac{4}{9}$	
$\frac{1}{6}$		$\frac{6}{10}$	

Alfakids.org

Educação Infantil e Ensino Fundamental I - Todos os direitos reservados©

Escreva a fração que indica a parte rachurada de cada figura.

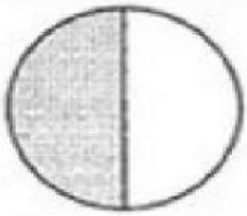

_____

G)

_____

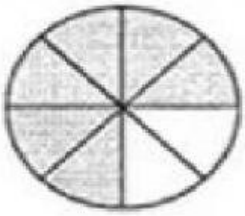

_____

H)

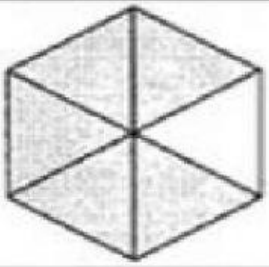

_____

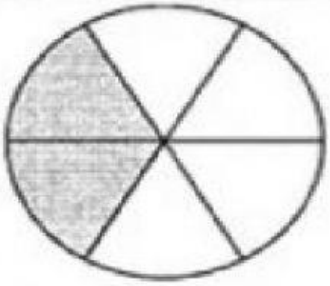

_____

I)

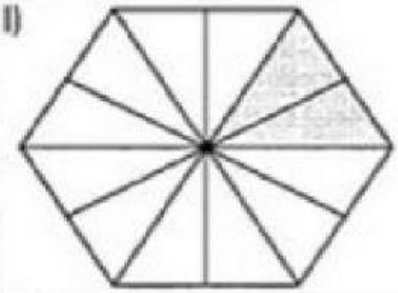

_____

LIVEWORKSHEETS