ALLTIMEWORKSHEETS

4.G.1

I can draw points, lines, line segments, rays, angles (right, acute, and obtuse), and perpendicular and parallel lines.

I will identify these in two-dimensional figures.

Draw a line from the word on the left to the example on the right.

Point	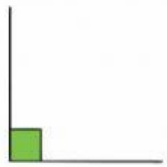
Line	
Line segment	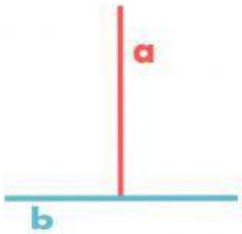
Ray	
Right angle	
Acute angle	
Obtuse angle	
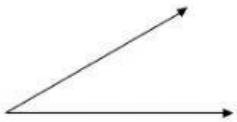
Parallel lines	
Perpendicular lines	
Intersecting lines