CÁLCULO DE ÁREA DE CUADRADOS, RECTÁNGULOS Y TRIÁNGULOS.

Nombre; _____

Recuerda: Áreas de Figuras 2D

Cuadrado	Rectángulo	Triángulo
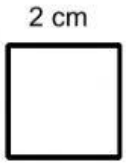 **Área:** Largo x Ancho	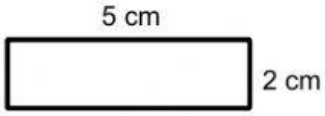 **Área:** Largo x Ancho	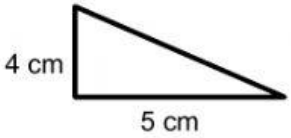 **Área:** $\frac{\textbf{Largo x Ancho}}{\textbf{2}}$
Ejemplo: $2\text{ cm} \times 2\text{ cm} = 4\text{ cm}^2$	**Ejemplo:** $5\text{ cm} \times 2\text{ cm} = 10\text{ cm}^2$	**Ejemplo:** $\frac{5\text{ cm} \times 4\text{ cm}}{2} = \frac{20\text{ cm}^2}{2} = 10\text{ cm}^2$

Calcula el área de las siguientes figuras 2D:

1)

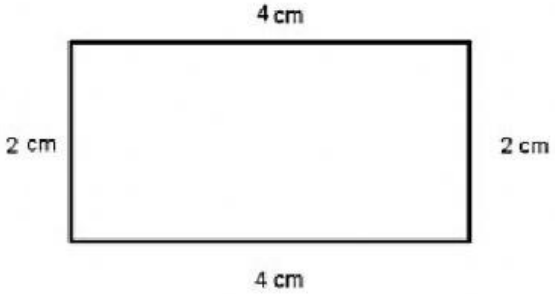

Área:_____cm^2

2)



Área:_____cm^2

LIVEWORKSHEETS

3)

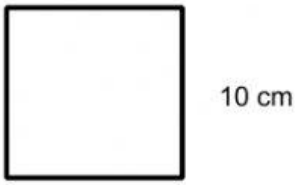

Área:_____cm^2

4)

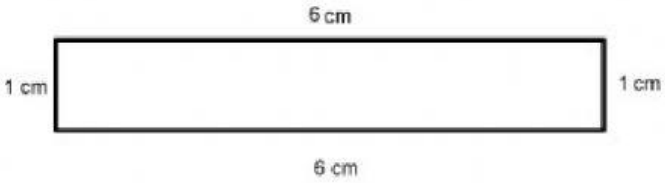

Área:_____cm^2

5)

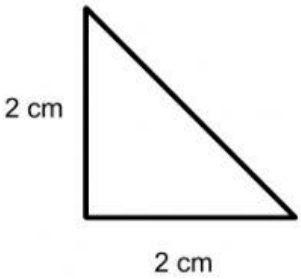

Área:_____cm^2

6)

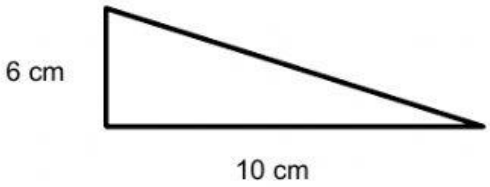

Área:_____cm^2

7)

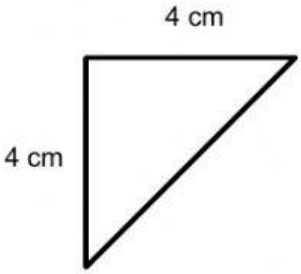

Área:_____cm^2

8)

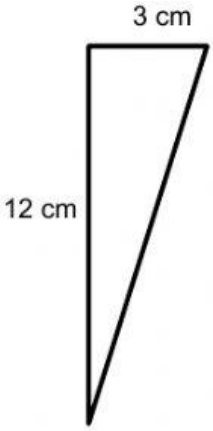

Área:_____cm^2

LIVEWORKSHEETS