RECOGNISE 2-D SHAPES

Activity 1

1 Join all the dots and write the name of the 2-D shapes.

a

b

c

d

2 Complete the sentences.

a

c o n r

s t i h

s d

b

c r v d

s d

c

o r e

s i t

s e

d

LIVEWORKSHEETS

Activity 2

1 Match.

a

b

c

d 

- 3 straight sides
- 4 straight sides
- 4 equal straight sides
- 1 curved side

2 Tick (✓) the objects that has the same surface.

a

b 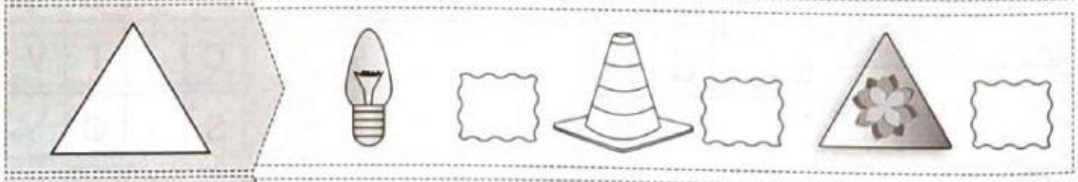

c 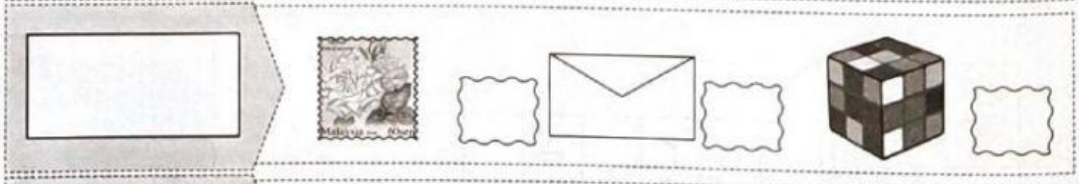

d 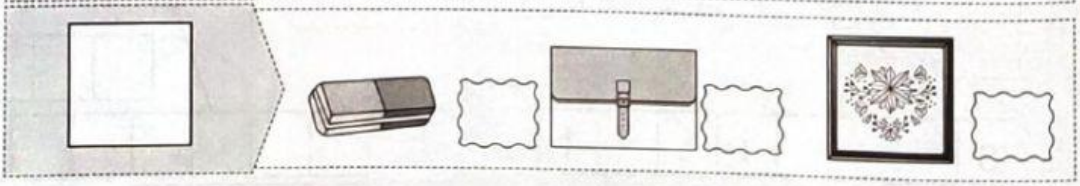

LIVEWORKSHEETS