MATHEMATIC YEAR 4 UNIT 2

NAME : CLASS :

Paper 2

1. (a) The diagram below consists of squares of equal size.



State the percentage of the shaded region of the whole diagram. [1 *mark*]

(b) The diagram below shows Bala's mathematics marks. Convert Bala's marks to percentage.

$$\frac{97}{100}$$

[1 *mark*]

2. (a) Match the fraction with the correct diagram. [1 *mark*]

UPSR 2017

$$\frac{8}{5}$$



(b) Convert $\frac{13}{3}$ to a mixed number. [1 *mark*]

LIVEWORKSHEETS

Paper 1

1. $5\frac{3}{4}$ in percentage is

   A 510%
   B 575%
   C 534%
   D 675%

2. Which of the following has the total sum of $7\frac{5}{6}$?

   A $4\frac{1}{2} + 3\frac{2}{3}$
   B $3\frac{5}{6} + 3\frac{1}{2}$
   C $5\frac{1}{2} + 2\frac{1}{3}$
   D $3\frac{2}{3} + 4\frac{1}{2}$

3. UPSR 2016 The diagram below shows two squares of equal size. Each square is divided into several equal parts.

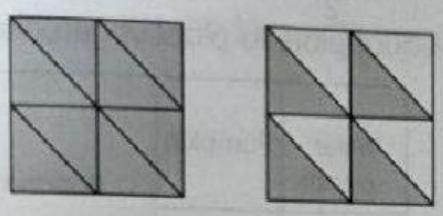

   Calculate the percentage of the shaded region in both squares.

   A 125%
   B 140%
   C 150%
   D 180%

4. Puan Salina bought 5 kg of white rice, $1\frac{1}{2}$ kg of glutinous rice and $2\frac{4}{5}$ kg of brown rice. What is the total mass, in kg, of rice bought by her?

   A $8\frac{1}{2}$ kg
   B $8\frac{5}{7}$ kg
   C $8\frac{9}{10}$ kg
   D $9\frac{3}{10}$ kg

5. UPSR 2017 The diagram below shows the conversation between a teacher and Aida.

   Teacher: Aida, please shade 34% on the hundred squared card provided.
   Aida : Yes, teacher.

   Which of the following correctly shows Aida's shaded region?

   A



   B



   C



   D



6. $3\frac{1}{4}$ of 96 =

   A 24
   B 72
   C 292
   D 312

LIVEWORKSHEETS