COLEGIO ALEMAN DE ARICA
DEUTSCHE SCHULE ARICA
Avda. Humberto Palza Nº 3727- Valle de Azapa
Email: secretaria@dsarica.cl Fono (58) 2242466
Web: www.colegioalemandearica.cl

RETO DEL DÍA



1. *Calcular el área de los siguientes prismas*

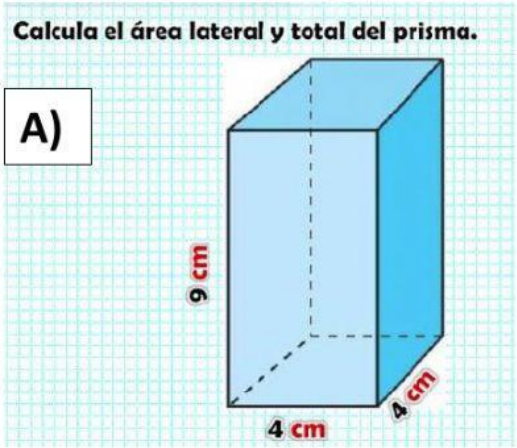

El área es :

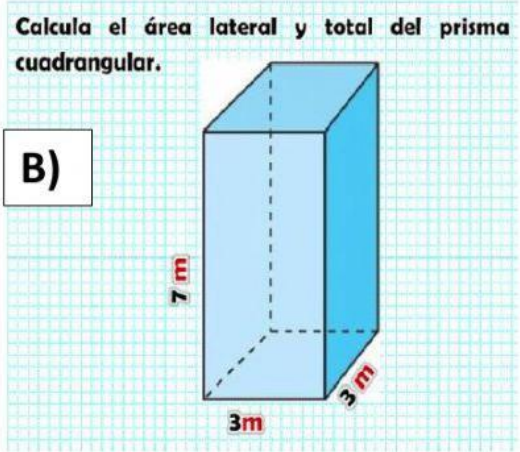

El área es:

2. *Calcular el área de los siguientes cilindro.* $\pi = 3{,}14$

A)

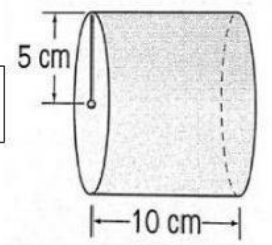

B)

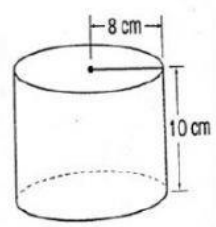

El área es:

El área es:

LIVEWORKSHEETS