Add and Subtract 10s

4a. Cross out the counters that need to be subtracted to match the calculation. Record your answer in the column format.

43 – 30 = 13

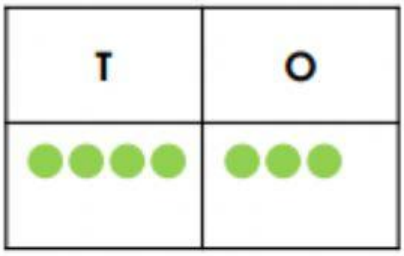



PS

Add and Subtract 10s

4b. Cross out the counters that need to be subtracted to match the calculation. Record your answer in the column format.

75 – 40 = 35

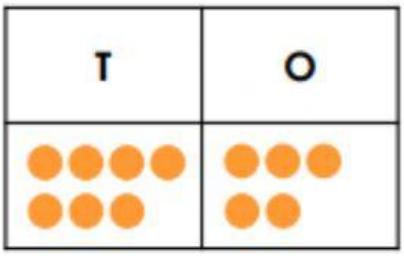



PS

5a. Katie is given a problem:

I have 24 sweets and I am given 30 more.

	2	4
+	3	0
	5	0

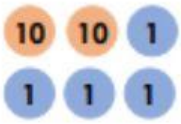

This is her calculation.
Is she correct? Explain why.

PS

5b. Noah is given a problem:

I have 46 strawberries and I eat 20 of them.

	4	6
–	2	0
	6	6

This is his calculation.
Is he correct? Explain why.

PS

6a. Insert the correct symbols in the boxes below.

	2	3
☐	1	0
	1	3

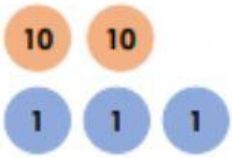

	3	7
☐	2	0
	5	7

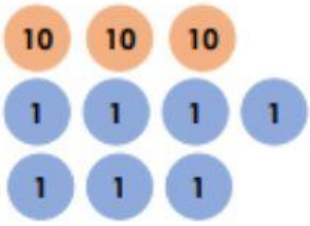

R

6b. Insert the correct symbols in the boxes below.

	1	2
☐	3	0
	4	2

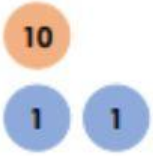

	4	8
☐	3	0
	1	8

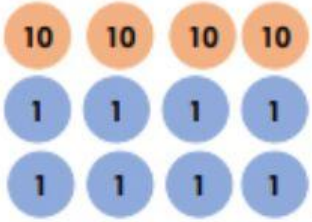

R

© Classroom Secrets Limited 2018

classroomsecrets.co.uk

LIVEWORKSHEETS