Complete the concept map about the respiratory system:

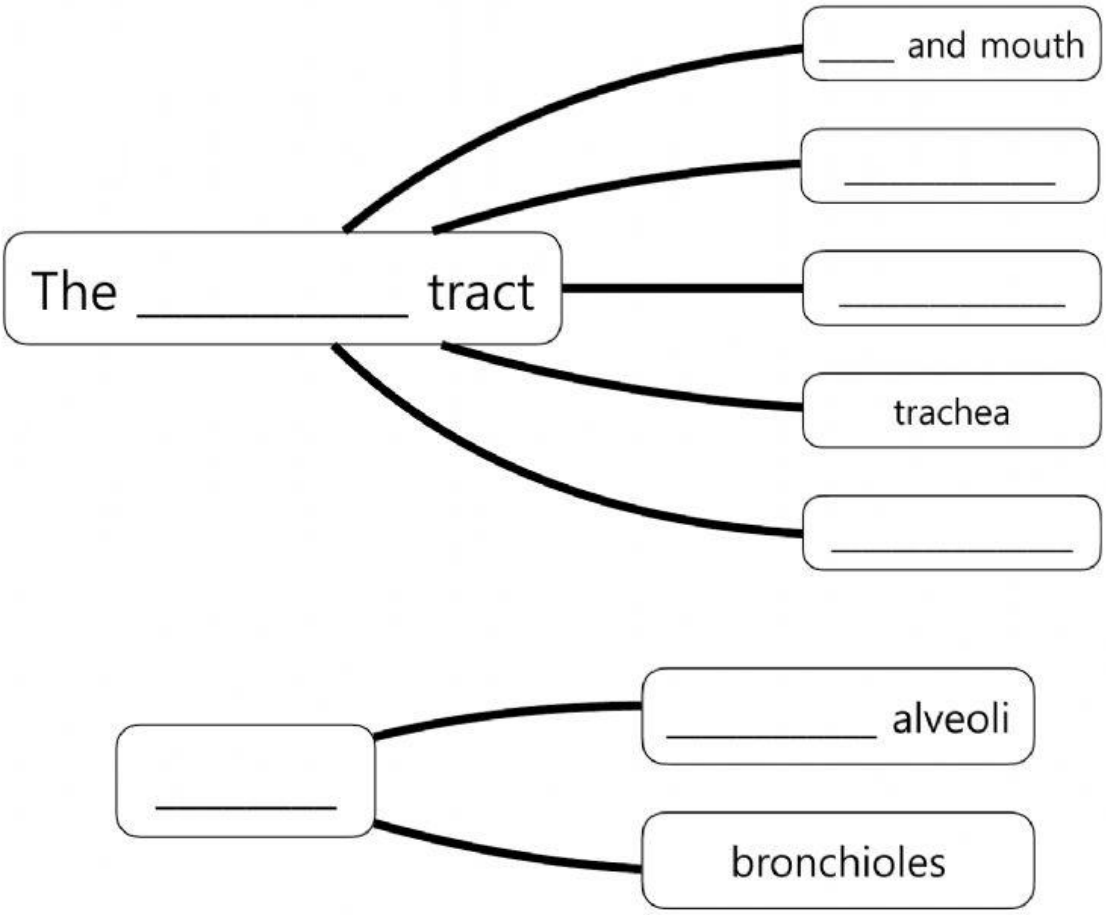

LIVEWORKSHEETS

Complete the picture with the parts of the respiratory system:

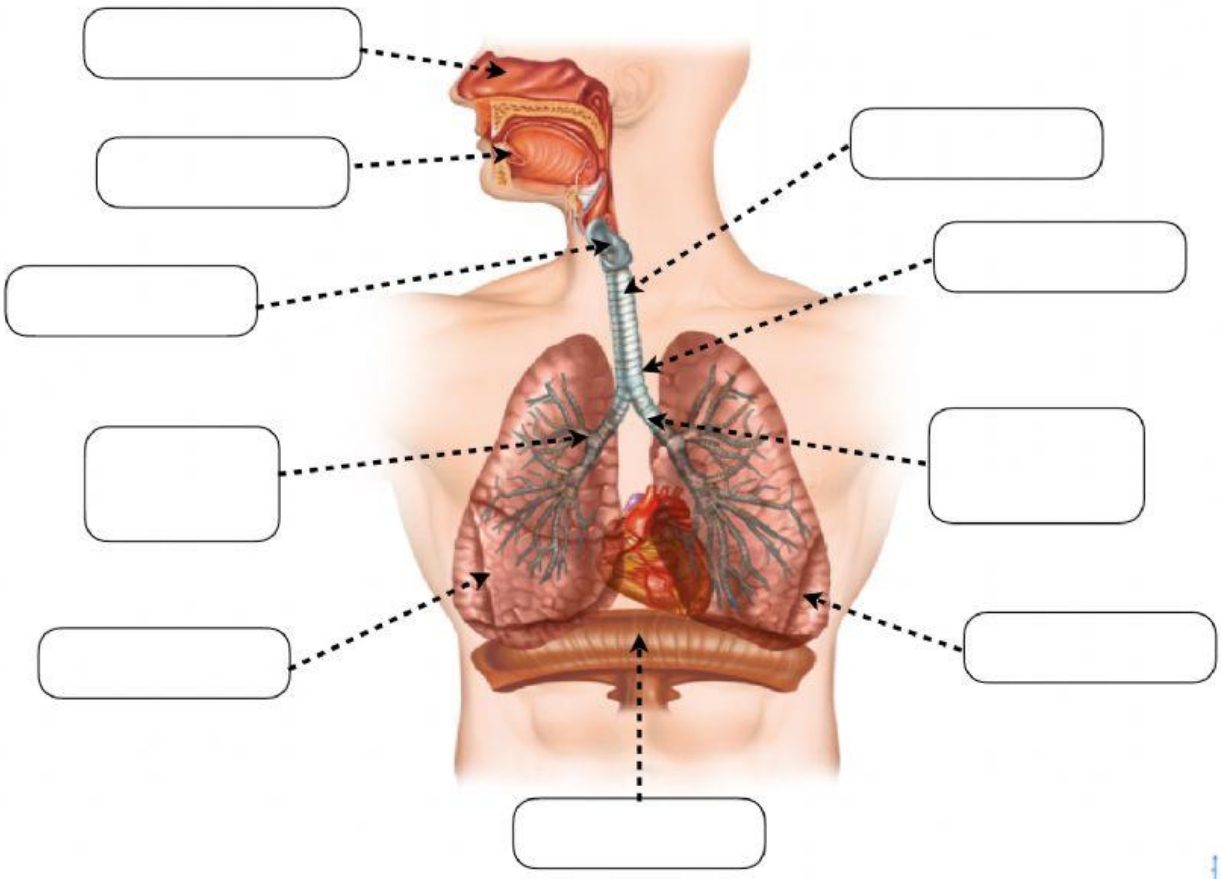

LIVEWORKSHEETS

Match the parts of the respiratory system to their definitions:

1. Mouth and nose
2. Vocal cords
3. Bronchioles
4. Lungs
5. Trachea
6. Bronchi
7. Alveoli

A. two smaller tubes that connect the trachea and the lungs
B. two large bags
C. long, rigid tube
D. air enters the body through them
E. tiny sacs in the lungs
F. small tubes inside the lungs
G. they vibrate and enable us to speak

LIVEWORKSHEETS

Complete the text about the movement of the lungs, INHALATION, using the words in the box:

ribcage	lungs	downwards	inhale	inflate	bigger	contracts

When we _____, the diaphragm _____ and pulls _____, the intercostal muscles contract and lift the _____.

The space inside the _____ is _____ so they inflate and take the air.

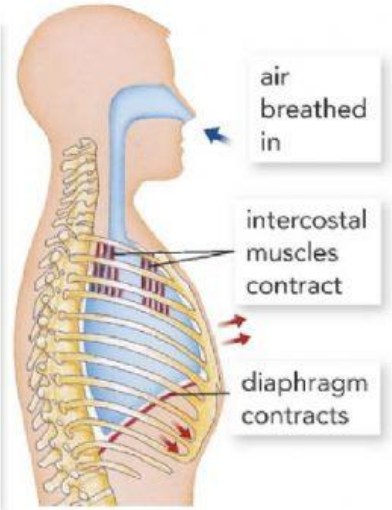

LIVEWORKSHEETS

Complete the text about the movement of the lungs, EXHALATION, using the words in the box:

intercostal	lungs	diaphragm	exhale	relax	smaller	getting

When we _____, the _____ and the _____ muscles _____.

The space in the _____ becomes _____, pushing out the air that they contain and _____ smaller.

LIVEWORKSHEETS

Complete with the words in the box:

mouth	vocal cords	trachea	bronchi	lungs	bronchioles

_____ _____ They produce sound when air passes over them.

_____ They are two large bags that are connected to the bronchi.

_____ Air enters the body through this.

_____ They are small tubes inside the lungs.

_____ They are tubes that connect the trachea to the lungs.

_____ A long tube that connects the mouth to the bronchi.

LIVEWORKSHEETS