LATIHAN PETUA SINUS DAN PETUA KOSINUS

ARAHAN: ISI TEMPAT KOSONG DANBERIKAN JAWAPAN AKHIR BETUL SEHINGGA 3 TEMPAT PERPULUHAN

Bil	Cari nilai x dan/atau y	Jalan Kerja/Langkah
1	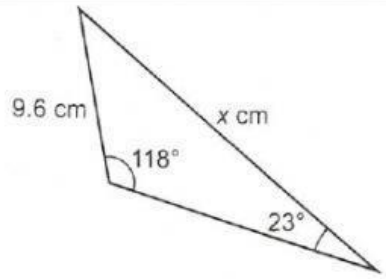	$\frac{x}{\sin} = \frac{\quad}{\sin}$ $x =$
2	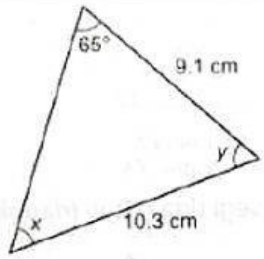	$\frac{\sin x}{\quad} = \frac{\sin}{\quad}$ $x =$ $y =$
3	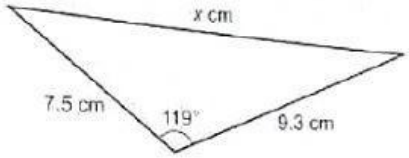	$x^2 = \quad^2 + \quad^2 - 2(\quad)(\quad)kos$ $x =$
4	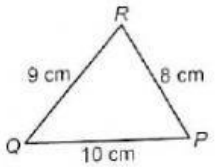 Hitung $\angle PRQ$ dalam segi tiga PQR. *Calculate $\angle PRQ$ in the triangle PQR.*	$^2 = \quad^2 + \quad^2 - 2(\quad)(\quad)kos\ \angle PRQ$ $\angle PRQ =$

LIVEWORKSHEETS