Calcule el lado desconocido de los triángulos rectángulos, arrastre al cuadro la respuesta correspondiente.

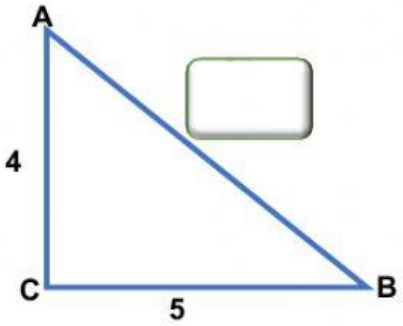

$\sqrt{41}$ $\sqrt{3}$ $\sqrt{13}$

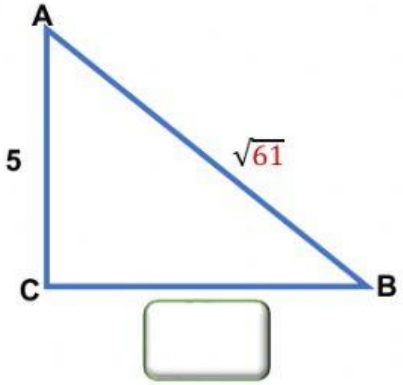

$\sqrt{36}$ 56 6

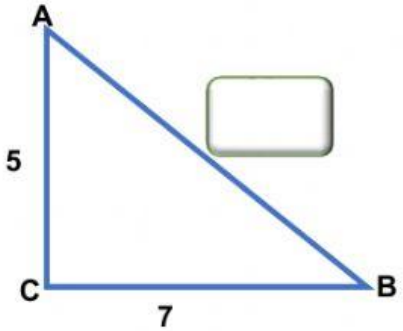

$\sqrt{24}$ 12 $\sqrt{74}$

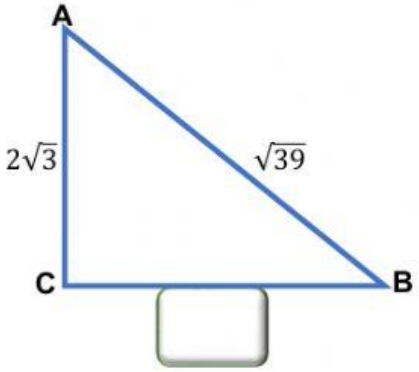

$5\sqrt{3}$ $4\sqrt{3}$ $3\sqrt{3}$

LIVEWORKSHEETS

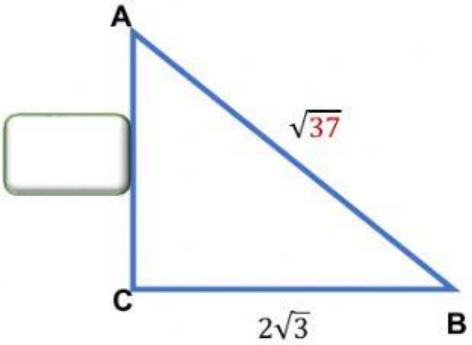

5 | **25** | 20

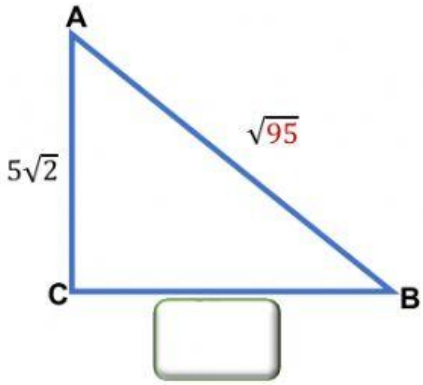

$3\sqrt{7}$ | $2\sqrt{5}$ | $3\sqrt{5}$

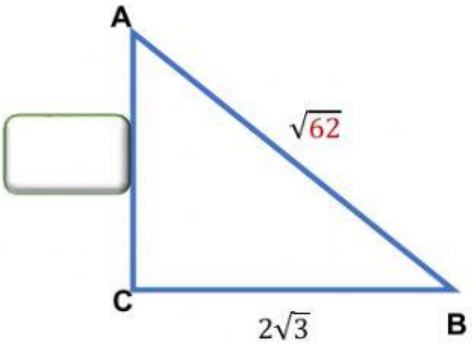

$5\sqrt{6}$ | $5\sqrt{5}$ | $5\sqrt{2}$

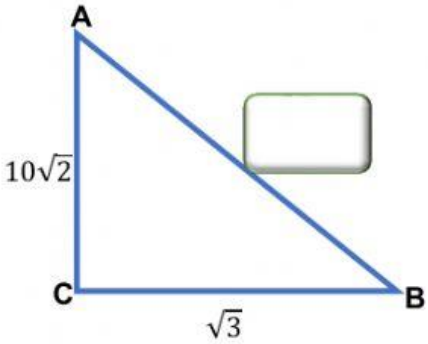

$3\sqrt{203}$ | $2\sqrt{203}$ | $\sqrt{203}$

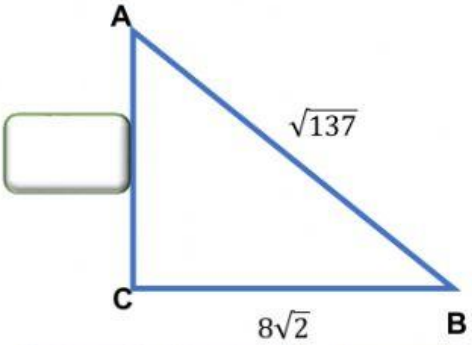

6 | 3 | 2

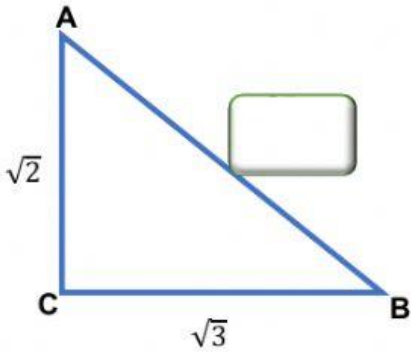

$\sqrt{5}$ | $2\sqrt{5}$ | 5

LIVEWORKSHEETS