La familia del 90

Bloques multibase

Asocie el número con su representación en los bloques multibase y escriba el número en la caja de valores



95

d	u

98

d	u

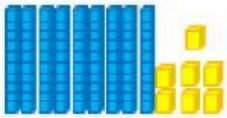

92

d	u



99

d	u



91

d	u

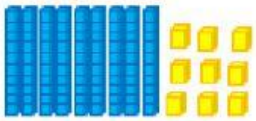

93

d	u



97

d	u



94

d	u

90

d	u



96

d	u

Ilustraciones tomadas de internet

Elaborado por Prof. Patricia Blanco Segura

LIVEWORKSHEETS