Name:_____

Mathematics Review 6

1. A dress cost $60.00. A discount of 10% was given. What is the new cost of the dress? $_____

2. A store opens Monday to Friday from 8:30 to 5:00pm. On Saturday it opened from 8:00am to 12:00pm. How many hours did the store open for the week? _____hours

3. Sherry spent $^{2}/_{5}$ of her allowance. She has $48.00 left. How much allowance did Sherry have at first? $_____

4. 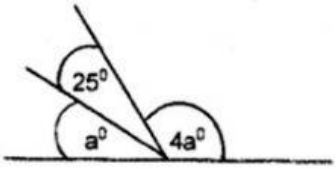

a=_____

5. $^{3}/_{8}$ of a number is 15. What is the number? _____

6. Change 4 $^{3}/_{4}$ hours to minutes. _____

LIVEWORKSHEETS

7. 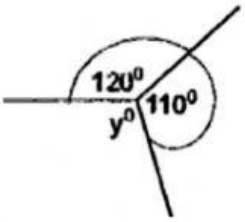

What is the value of y^0?

y=_____

8. At the end of the week father spent 60% of the $920.00 he earned. How much money did he have left?

$_____

In the diagram below RST is a straight line. Study the information carefully.

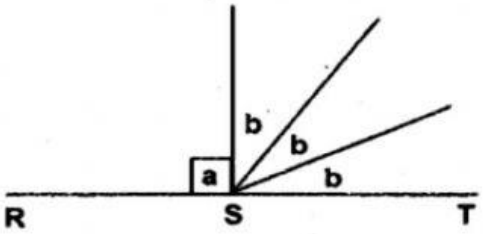

Calculate the value of angle a and angle b.

9. a^0 = _____

b^0 = _____

LIVEWORKSHEETS

10. Complete the statement below to make it correct.

3 metre = _____centimetres.

11. From a ribbon 6.39m long, 0.9m is cut off. What is the length of the remaining piece?

12. A cricket match between the Super Stars and England began at 5:30pm and lasted for 3 hours and 55 minutes. At what time did it end? _____

13. Anastasia has 3 metres of cloth from which she cuts 4 pieces each measuring 70cm long. What length of the cloth was left over? _____cmd

LIVEWORKSHEETS