BELAJAR MEMBUAT SOAL DI LIVE WORKSHEET
(BELAJAR MATEMATIKA)

1 Pilihan Ganda

Berikut ini yang termasuk gambar balok adalah ....

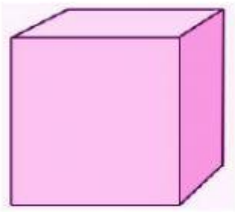

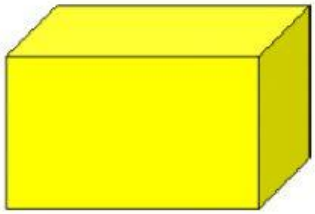

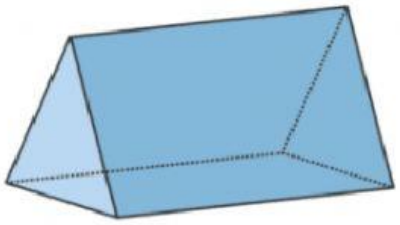

2 Isian singkat/essai

Nama bangun di samping adalah .....

Jelaskan apa yang kamu ketahui tentang gambar di samping!

3 Drop Down

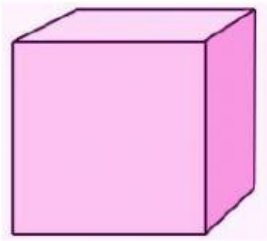

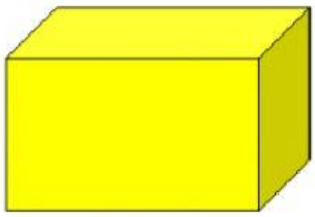

LIVEWORKSHEETS

4 Check Box

Berikut ini yang merupakan gambar bangun ruang adalah .....

- Lingkaran
- Kerucut
- Balok
- Persegi

5 Join Arrow

Jodohkan antara gambar dan nama bangun dengan cara menarik garis penghubung!

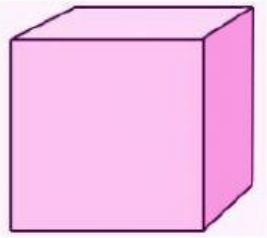



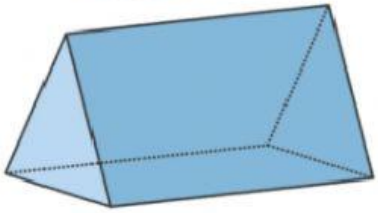

- Prisma
- Kerucut
- Bola
- Kubus

LIVEWORKSHEETS

6 Drag and Drop

Tarik gambar berikut ke dalam kotak yang sesuai!

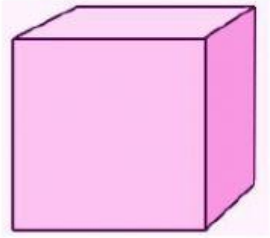



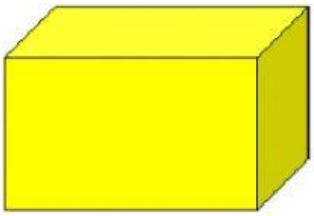

Balok	Kubus	Kerucut

7 Listening

Dengarkan suaranya, dan pilih benar atau salah!

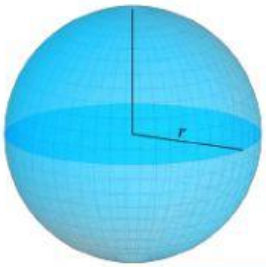

Benar	Salah	Benar	Salah

LIVEWORKSHEETS

8 Speaking

Rekam suaramu untuk menyebutkan nama bangun berikut dengan cara menekan tombol rekam!

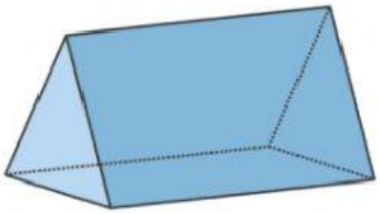

9 Word Search

Carilah nama-nama bangun ruang!

A	B	A	L	I	N	G	U
T	A	P	U	T	R	R	O
P	L	P	R	I	S	M	A
B	O	C	D	K	E	F	G
L	K	E	R	U	C	U	T
O	O	T	A	B	U	N	G
K	L	U	I	U	J	I	H
L	I	M	A	S	K	U	I

LIVEWORKSHEETS