Name		Mark Scored	
Class	Primary 2		
Date		Parent's Signature	
Duration	40 minutes		

A. Choose the correct answer. Write a, b, c, or d in the brackets provided. (1 mark each)

Look at the pictures below to answer number 1-3.



1. How many plates are there? ( )

a. 2 b. 3 c. 5 d. 6

2. How many apples are there on each plate? ( )

a. 2 b. 3 c. 5 d. 6

3. How many apples are there altogether? ( )

a. 2 b. 3 c. 5 d. 6

LIVEWORKSHEETS

Look at the pictures below to answer number 4-5.





4. An ant has _____ legs. ( )

a. 3 b. 6 c. 12 d. 18

5. 3 ants have _____ legs. ( )

a. 3 b. 6 c. 12 d. 18

6. Look at the pictures below!

5 + 5 + 5 + 5 = _____.

How many diamonds are there altogether?

a. 5 b. 10 c. 15 d. 20

LIVEWORKSHEETS

7. Look at the pictures below!



4 + 4 + 4 + 4 + 4 = 20.

_____ × 4 = 20

What number to fill in the blank?

a. 2 b. 3 c. 4 d. 5

Look at the pictures below to answer number 8-10.

8. How many jars are there? ( )

a. 2 b. 4 c. 5 d. 10

9. How many stars are there in each jar? ( )

a. 2 b. 4 c. 5 d. 10

10. How many stars are there altogether?

2 × 5 = 5 + 5 = _____ ( )

a. 2 b. 4 c. 5 d. 10

LIVEWORKSHEETS

B. Solve the problem. **(Total mark: 10)**

11. Mary has 2 groups of books. (3)

Each group has 8 books.

1) _____ + _____ = _____

2) _____ × _____ = _____

3) There are _____ books altogether.

12. Tell a multiplication story about these baby tortoises. (4)



1) I see _____ groups of tortoises.

2) Each group has _____ tortoises.

3) _____ × _____ = _____

4) There are _____ tortoises.

LIVEWORKSHEETS

For number 13 until 15, write the multiplication sentences. (3)

13.

_____

14.



_____

15.



_____

LIVEWORKSHEETS