Application

Temperature- Is it **hot** or **cold** ?

Chose the correct answer. (1pt.each)

hot cold	hot cold	hot cold
hot cold	hot cold	hot cold

Look at the picture, is it hot or cold?

_____

What item will warm you up when it is cold?

LIVEWORKSHEETS

Concepts

Write **L** for light items and **H** for heavy items



Which object is heavier?



Which object is lighter?



Computation

Count the ten frame. Write the teen number on the line. (1pt. each)

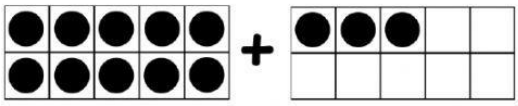

= _____

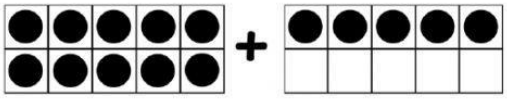

= _____

LIVEWORKSHEETS

 = _____

 = _____

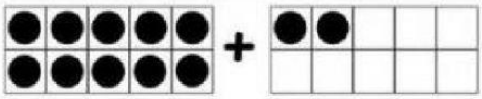 = _____

LIVEWORKSHEETS