NAMA :

KELAS :

Cikgu Azmira

ISI TEMPAT KOSONG DENGAN METER YANG BETUL.

$\frac{4}{4}$ $\frac{2}{4}$ $\frac{3}{4}$

Corak Irama 1



Corak Irama 2

Corak Irama 3

$\frac{3}{4}$ $\frac{2}{4}$ $\frac{4}{4}$







LIVEWORKSHEETS